Fraction Models (F)

Color sections of each circle to model each fraction.

1. 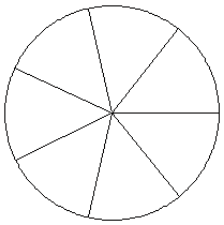

$\frac{2}{7}$

2. 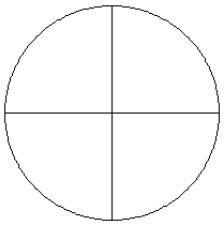

$\frac{2}{4}$

3. 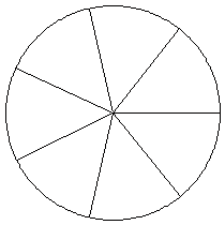

$\frac{4}{7}$

4. 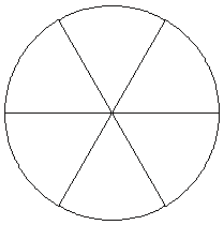

$\frac{4}{6}$

5. 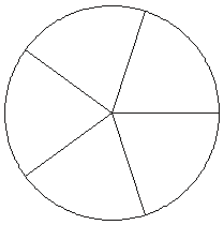

$\frac{2}{5}$

6. 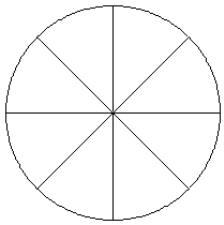

$\frac{7}{8}$

7. 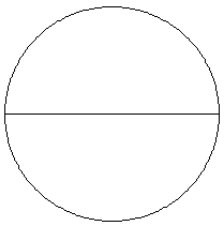

$\frac{1}{2}$

8. 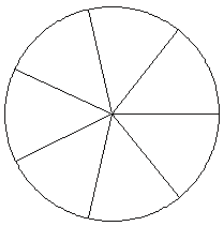

$\frac{4}{7}$

9. 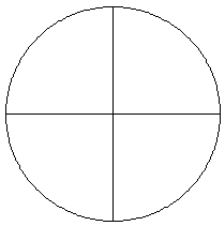

$\frac{1}{4}$

10. 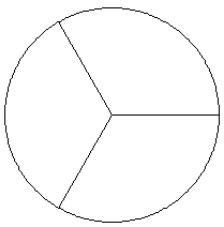

$\frac{0}{3}$

11. 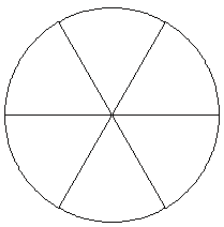

$\frac{1}{6}$

12. 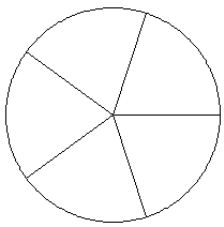

$\frac{3}{5}$

Fraction Models (F) Answers

Color sections of each circle to model each fraction.

1. 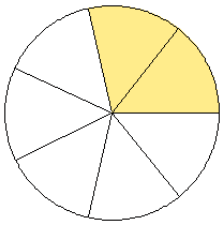

2. 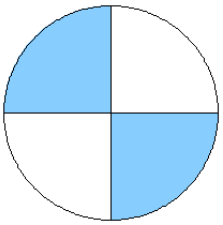

3. 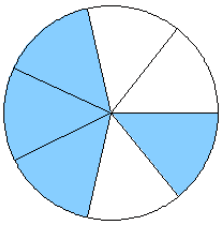

4. 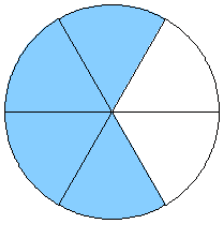

5. 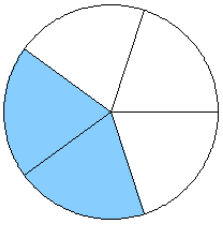

6. 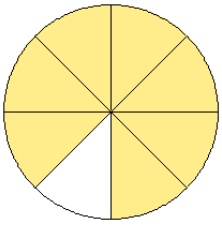

7. 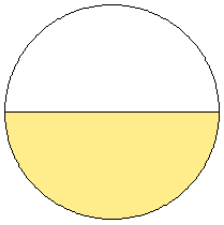

8. 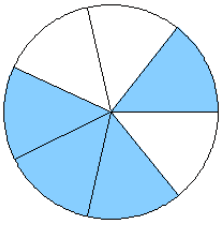

9. 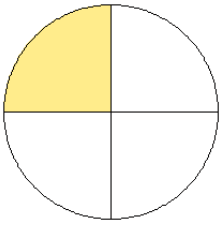

10. 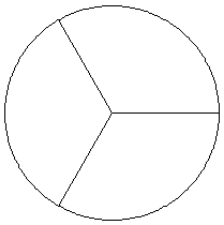

11. 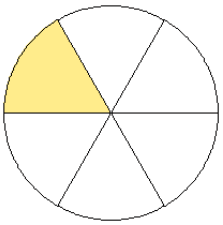
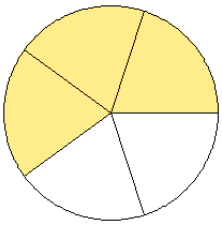
12.