Rounding Fractions (C)

Name: _____ Date: _____

Round each fraction to the nearest half. Round up if it's a tie.

1. $\frac{8}{11} \simeq$

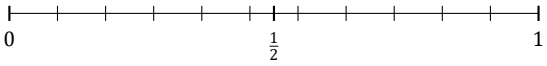

2. $\frac{8}{9} \simeq$

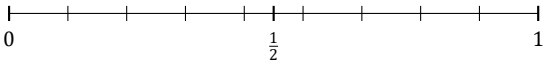

3. $\frac{4}{7} \simeq$

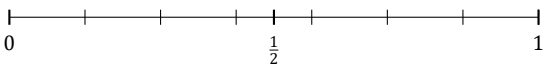

4. $\frac{3}{7} \simeq$

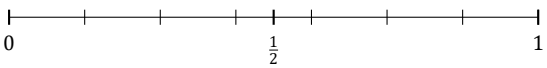

5. $\frac{1}{2} \simeq$

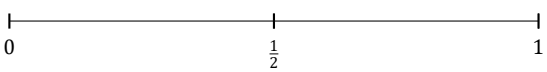

6. $\frac{5}{7} \simeq$

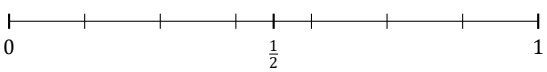

7. $\frac{5}{9} \simeq$

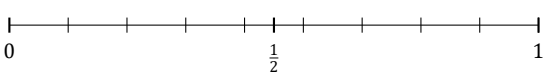

8. $\frac{10}{12} \simeq$

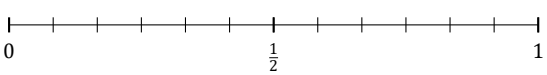

9. $\frac{6}{12} \simeq$

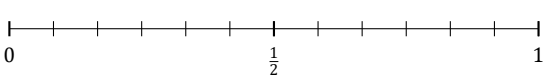

10. $\frac{4}{9} \simeq$

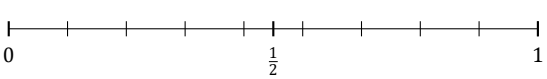

11. $\frac{2}{7} \simeq$

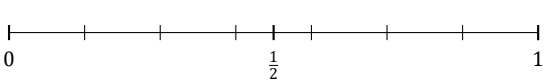

12. $\frac{2}{8} \simeq$

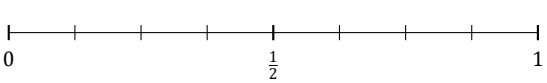

13. $\frac{5}{11} \simeq$

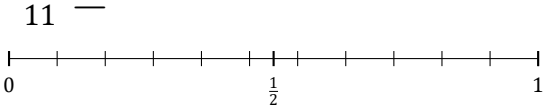

14. $\frac{3}{8} \simeq$

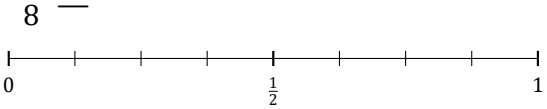

15. $\frac{2}{6} \simeq$

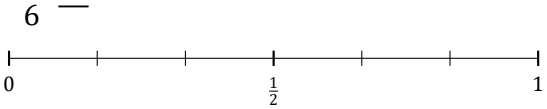

16. $\frac{3}{9} \simeq$

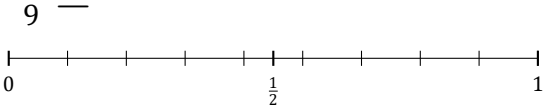

17. $\frac{1}{9} \simeq$

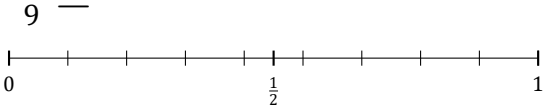

18. $\frac{2}{3} \simeq$

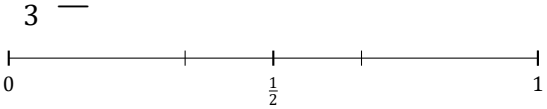

19. $\frac{8}{10} \simeq$

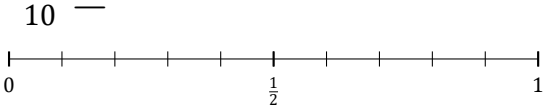
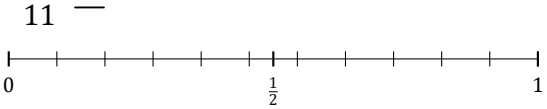
20. $\frac{4}{11} \simeq$