Rounding Fractions (H)

Name: _____ Date: _____

Round each fraction to the nearest whole. Round up if it's a tie.

1. $\frac{2}{5} \simeq$

0 1

2. $\frac{7}{11} \simeq$

0 1

3. $\frac{4}{12} \simeq$

0 1

4. $\frac{1}{10} \simeq$

0 1

5. $\frac{2}{4} \simeq$

0 1

6. $\frac{3}{9} \simeq$

0 1

7. $\frac{5}{9} \simeq$

0 1

8. $\frac{8}{12} \simeq$

0 1

9. $\frac{6}{7} \simeq$

0 1

10. $\frac{1}{6} \simeq$

0 1

11. $\frac{4}{6} \simeq$

0 1

12. $\frac{6}{9} \simeq$

0 1

13. $\frac{1}{9} \simeq$

0 1

14. $\frac{10}{12} \simeq$

0 1

15. $\frac{4}{8} \simeq$

0 1

16. $\frac{7}{9} \simeq$

0 1

17. $\frac{10}{11} \simeq$

0 1

18. $\frac{3}{12} \simeq$

0 1

19. $\frac{4}{11} \simeq$

0 1

20. $\frac{1}{2} \simeq$

0 1

Rounding Fractions (H) Answers

Name: _____ Date: _____

Round each fraction to the nearest whole. Round up if it's a tie.

1. $\frac{2}{5} \simeq 0$

2. $\frac{7}{11} \simeq 1$

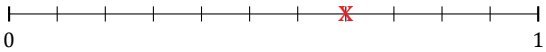

3. $\frac{4}{12} \simeq 0$

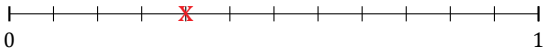

4. $\frac{1}{10} \simeq 0$

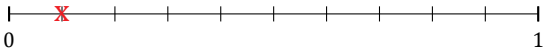

5. $\frac{2}{4} \simeq 1$



6. $\frac{3}{9} \simeq 0$

7. $\frac{5}{9} \simeq 1$

8. $\frac{8}{12} \simeq 1$

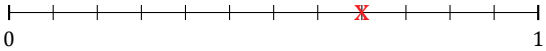

9. $\frac{6}{7} \simeq 1$



10. $\frac{1}{6} \simeq 0$

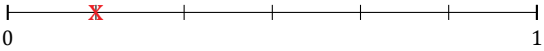

11. $\frac{4}{6} \simeq 1$

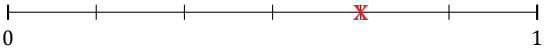

12. $\frac{6}{9} \simeq 1$

13. $\frac{1}{9} \simeq 0$

14. $\frac{10}{12} \simeq 1$

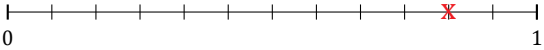

15. $\frac{4}{8} \simeq 1$

16. $\frac{7}{9} \simeq 1$

17. $\frac{10}{11} \simeq 1$

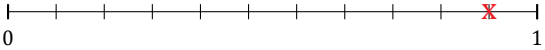

18. $\frac{3}{12} \simeq 0$

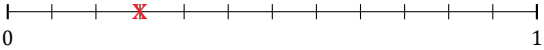

19. $\frac{4}{11} \simeq 0$

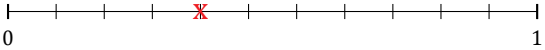
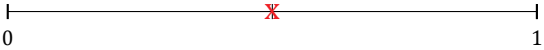
20. $\frac{1}{2} \simeq 1$