Classifying Prisms and Pyramids (G)

Name each figure based on the shape of its base.

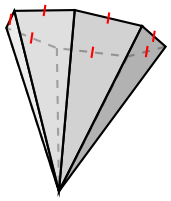

_____

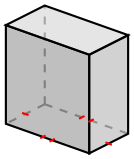

_____

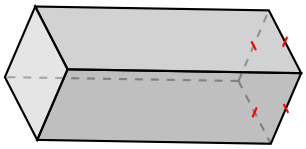

_____

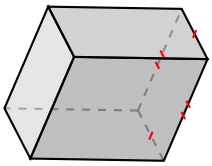

_____

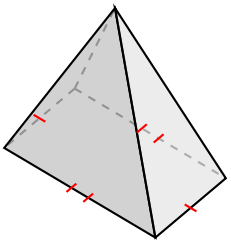

_____

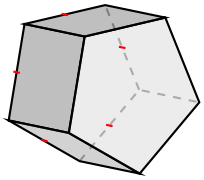

_____

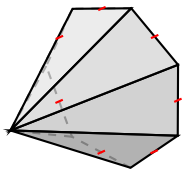

_____

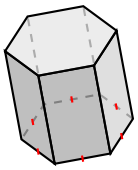

_____

Classifying Prisms and Pyramids (G) Answers

Name each figure based on the shape of its base.

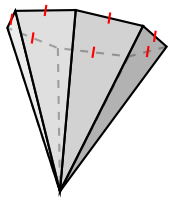

heptagonal pyramid

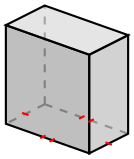

rectangular prism

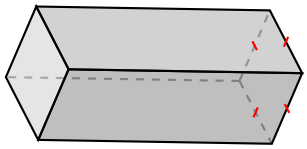

square prism

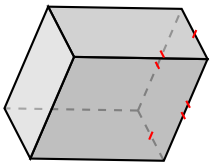

rectangular prism

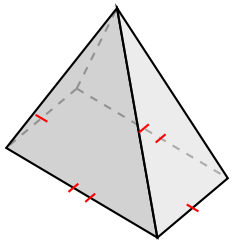

rectangular pyramid

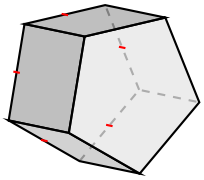

pentagonal prism

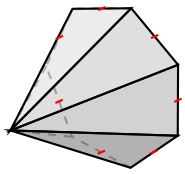

heptagonal pyramid

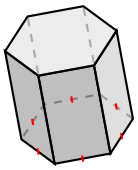

hexagonal prism