Classifying Triangles by Angle Properties (D)

Name: _____ Date: _____

Classify each triangle using its angle properties.

1. 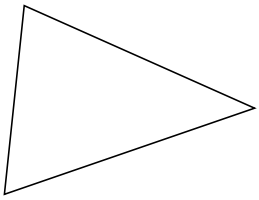

_____

2. 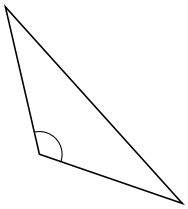

_____

3. 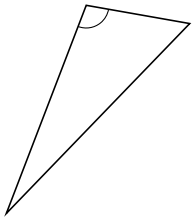

_____

4. 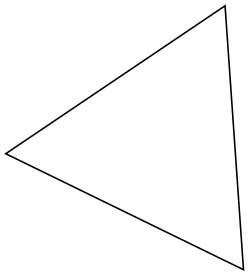

_____

5. 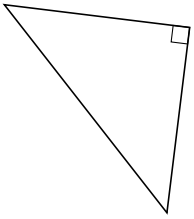

_____

6. 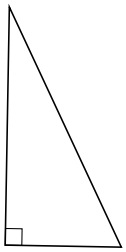

_____

7. 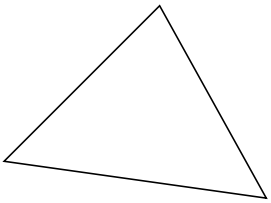

_____

8. 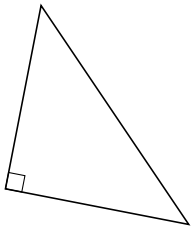

_____

9. 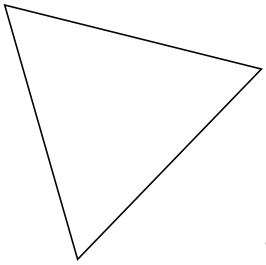

_____

10. 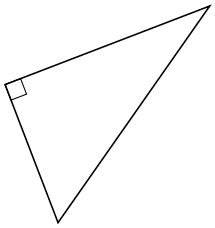

_____

Classifying Triangles by Angle Properties (D) Answers

Name: _____ Date: _____

Classify each triangle using its angle properties.

1. 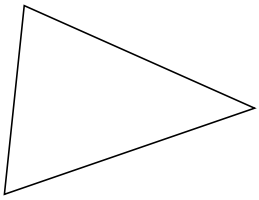

acute

2. 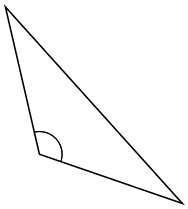

obtuse

3. 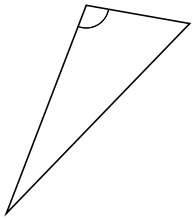

obtuse

4. 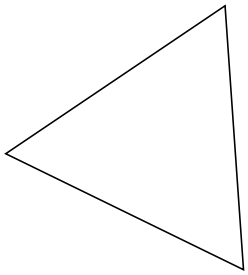

acute

5. 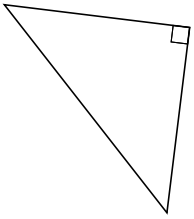

right

6. 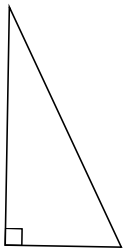

right

7. 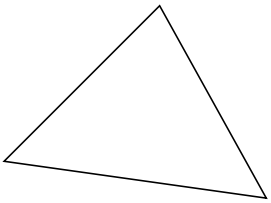

acute

8. 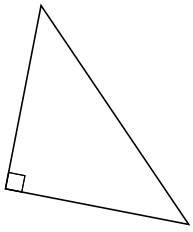

right

9. 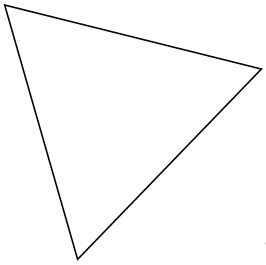

acute

10. 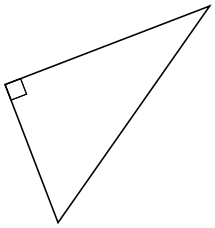

right