Classifying Triangles by Angle Properties (J)

Name: _____ Date: _____

Classify each triangle using its angle properties.

1. 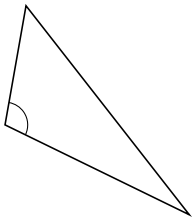

_____

2. 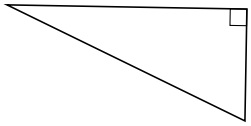

_____

3. 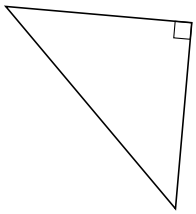

_____

4. 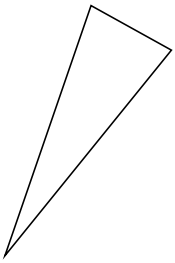

_____

5. 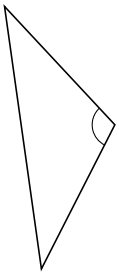

_____

6. 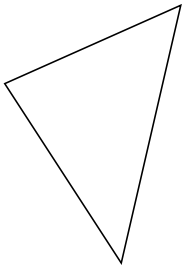

_____

7. 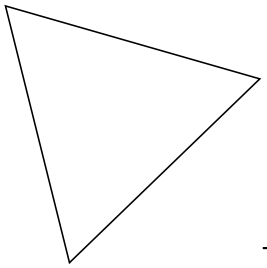

_____

8. 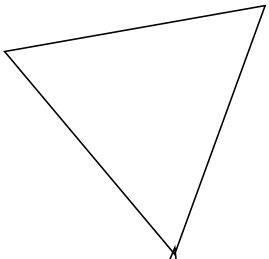

_____

9. 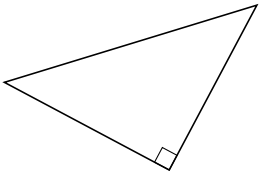

_____

10. 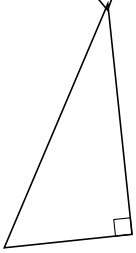

_____

Classifying Triangles by Angle Properties (J) Answers

Name: _____ Date: _____

Classify each triangle using its angle properties.

1. 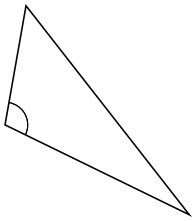
obtuse

2. 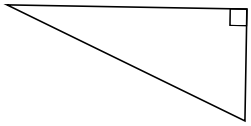
right

3. 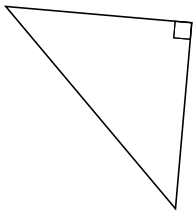
right

4. 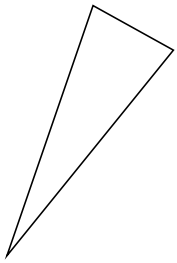
acute

5. 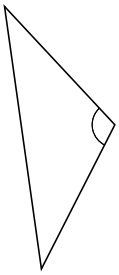
obtuse

6. 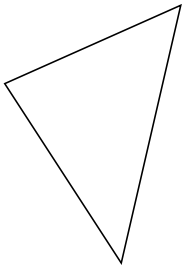
acute

7. 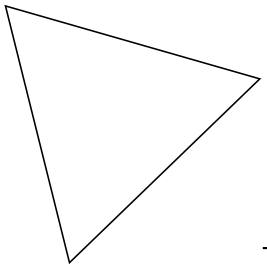
acute

8. 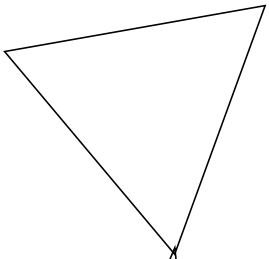
acute

9. 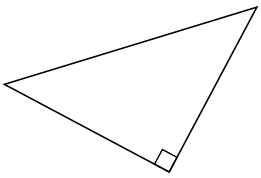
right

10. 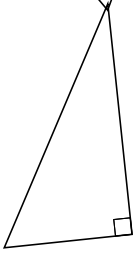
right