Classifying Triangles by Angle and Side Properties (H)

Name: _____ Date: _____

Classify each triangle using its angle and side properties.

1. 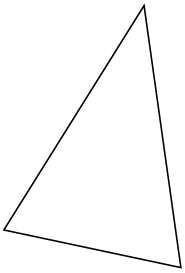

_____

2. 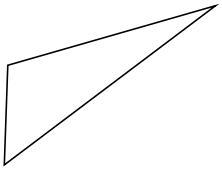

_____

3. 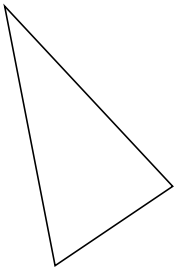

_____

4. 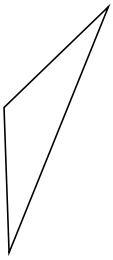

_____

5. 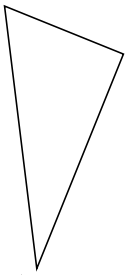

_____

6. 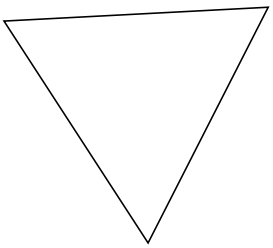

_____

7. 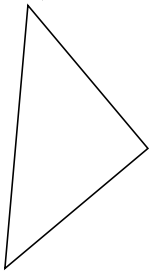

_____

8. 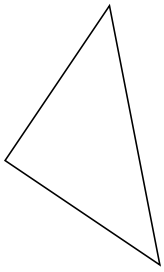

_____

9. 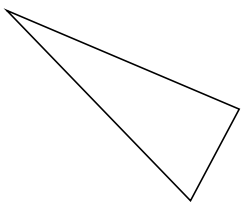

_____

10. 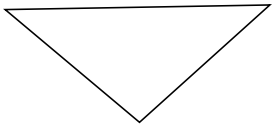

_____

Classifying Triangles by Angle and Side Properties (H) Answers

Name: _____ Date: _____

Classify each triangle using its angle and side properties.

1. 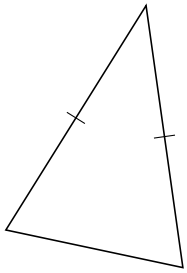

acute isosceles

2. 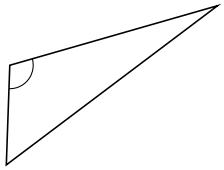

obtuse scalene

3. 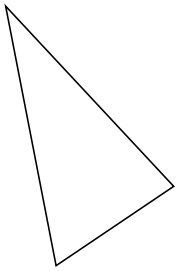

acute scalene

4. 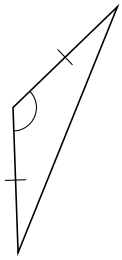

obtuse isosceles

5. 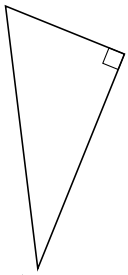

right scalene

6. 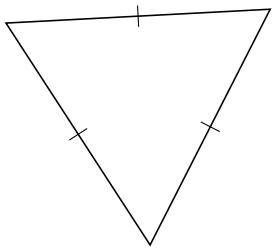

acute equilateral

7. 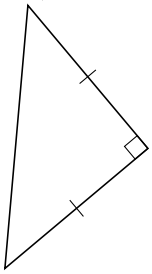

right isosceles

8. 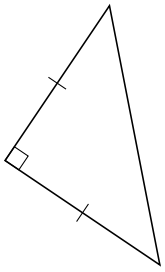

right isosceles

9. 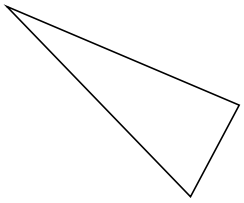

acute scalene

10. 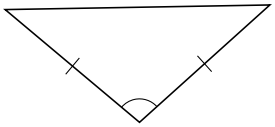

obtuse isosceles