Sine Ratio (G)

Name: _____ Date: _____

Calculate the angle values using the sine ratio: $sin(\alpha) = \frac{O}{H}$

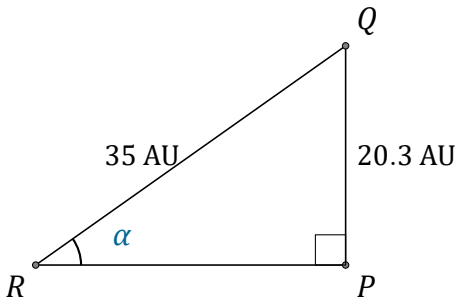

$\alpha = \angle PRQ =$ _____

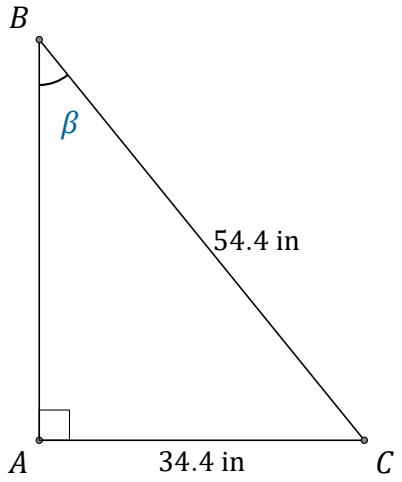

$\beta = \angle ABC =$ _____

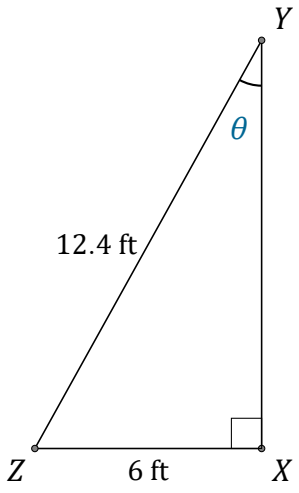

$\theta = \angle XYZ =$ _____

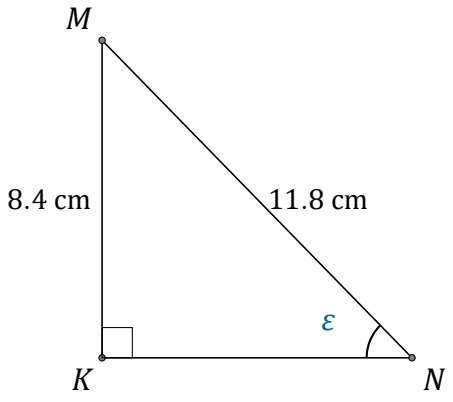

$\varepsilon = \angle KNM =$ _____