HALLOWEEN COUNTING (A)

Name: _____ Date: _____ Score: _____ /4

Count the number of items in each group, if you dare!

1. There are ☐ witches.

2. There are ☐ jack-o'-lanterns.

3. There are ☐ bats.



4. There are ☐ ghosts.



HALLOWEEN COUNTING (A) ANSWERS

Name: _____ Date: _____ Score: _____ /4

Count the number of items in each group, if you dare!

1. There are 6 witches.

2. There are 24 jack-o'-lanterns.

3. There are 9 bats.



4. There are 40 ghosts.



HALLOWEEN COUNTING (B)

Name: _____ Date: _____ Score: _____ /4

Count the number of items in each group, if you dare!

1. There are ☐ jack-o'-lanterns.

2. There are ☐ witches.



3. There are ☐ bats.



4. There are ☐ ghosts.



HALLOWEEN COUNTING (B) ANSWERS

Name: _____ Date: _____ Score: _____ /4

Count the number of items in each group, if you dare!

1. There are 8 jack-o'-lanterns.

2. There are 56 witches.



3. There are 40 bats.



4. There are 6 ghosts.



HALLOWEEN COUNTING (C)

Name: _____ Date: _____ Score: _____ /4

Count the number of items in each group, if you dare!

1. There are ☐ witches.

2. There are ☐ jack-o'-lanterns.

3. There are ☐ ghosts.



4. There are ☐ bats.

Halloween Counting (C) Answers

Name: _____ Date: _____ Score: _____ /4

Count the number of items in each group, if you dare!

1. There are 13 witches.

2. There are 47 jack-o'-lanterns.

3. There are 64 ghosts.



4. There are 4 bats.

HALLOWEEN COUNTING (D)

Name: _____ Date: _____ Score: _____ /4

Count the number of items in each group, if you dare!

1. There are ☐ bats.



2. There are ☐ jack-o'-lanterns.

3. There are ☐ ghosts.



4. There are ☐ witches.

HALLOWEEN COUNTING (D) ANSWERS

Name: _____ Date: _____ Score: _____ /4

Count the number of items in each group, if you dare!

1. There are 6 bats.



2. There are 24 jack-o'-lanterns.

3. There are 27 ghosts.



4. There are 6 witches.

HALLOWEEN COUNTING (E)

Name: _____ Date: _____ Score: _____ /4

Count the number of items in each group, if you dare!

1. There are ☐ bats.



2. There are ☐ witches.



3. There are ☐ ghosts.

4. There are ☐ jack-o'-lanterns.

Halloween Counting (E) Answers

Name: _____ Date: _____ Score: _____ /4

Count the number of items in each group, if you dare!

1. There are 12 bats.



2. There are 12 witches.



3. There are 4 ghosts.

4. There are 38 jack-o'-lanterns.

HALLOWEEN COUNTING (F)

Name: _____ Date: _____ Score: _____ /4

Count the number of items in each group, if you dare!

1. There are ☐ jack-o'-lanterns.

2. There are ☐ ghosts.



3. There are ☐ bats.

4. There are ☐ witches.



HALLOWEEN COUNTING (F) ANSWERS

Name: _____ Date: _____ Score: _____ /4

Count the number of items in each group, if you dare!

1. There are 7 jack-o'-lanterns.

2. There are 56 ghosts.



3. There are 45 bats.

4. There are 9 witches.



HALLOWEEN COUNTING (G)

Name: _____ Date: _____ Score: _____ /4

Count the number of items in each group, if you dare!

1. There are ☐ jack-o'-lanterns.

2. There are ☐ witches.

3. There are ☐ ghosts.



4. There are ☐ bats.



HALLOWEEN COUNTING (G) ANSWERS

Name: _____ Date: _____ Score: _____ /4

Count the number of items in each group, if you dare!

1. There are 36 jack-o'-lanterns.

2. There are 8 witches.

3. There are 41 ghosts.



4. There are 7 bats.



HALLOWEEN COUNTING (H)

Name: _____ Date: _____ Score: _____ /4

Count the number of items in each group, if you dare!

1. There are ☐ witches.

2. There are ☐ jack-o'-lanterns.

3. There are ☐ ghosts.

4. There are ☐ bats.

HALLOWEEN COUNTING (H) ANSWERS

Name: _____ Date: _____ Score: _____ /4

Count the number of items in each group, if you dare!

1. There are 10 witches.

2. There are 7 jack-o'-lanterns.

3. There are 28 ghosts.

4. There are 41 bats.

HALLOWEEN COUNTING (1)

Name: _____ Date: _____ Score: _____ /4

Count the number of items in each group, if you dare!

1. There are ☐ jack-o'-lanterns.

2. There are ☐ witches.

3. There are ☐ ghosts.



4. There are ☐ bats.



HALLOWEEN COUNTING (I) ANSWERS

Name: _____ Date: _____ Score: _____ /4

Count the number of items in each group, if you dare!

1. There are 11 jack-o'-lanterns.

2. There are 5 witches.

3. There are 27 ghosts.



4. There are 12 bats.



HALLOWEEN COUNTING (J)

Name: _____ Date: _____ Score: _____ /4

Count the number of items in each group, if you dare!

1. There are ☐ witches.

2. There are ☐ jack-o'-lanterns.

3. There are ☐ ghosts.



4. There are ☐ bats.



Halloween Counting (J) Answers

Name: _____ Date: _____ Score: _____ /4

Count the number of items in each group, if you dare!

1. There are 13 witches.

2. There are 32 jack-o'-lanterns.

3. There are 25 ghosts.



4. There are 7 bats.