Through the Dark Forest (G)

Find each sum to find your way through the forest.



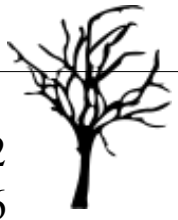

98
+ 73

49
+ 83

92
+ 96

96
+ 98

23
+ 91

46
+ 28

40
+ 56

10
+ 54

54
+ 42

16
+ 77

33
+ 78

88
+ 55

12
+ 40

34
+ 69

97
+ 41

59
+ 14

62
+ 65

49
+ 52

17
+ 34

37
+ 89

70
+ 23

65
+ 49

67
+ 51

65
+ 60

60
+ 39