Arc Angles (G)

Name: _____ Date: _____

Calculate each arc angle measurement.

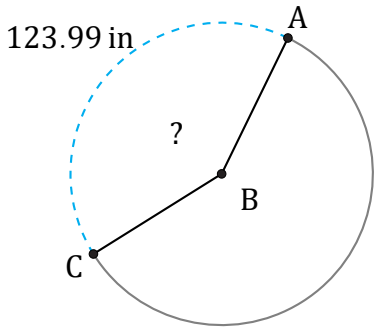

Diameter = 96 in

∠ABC =

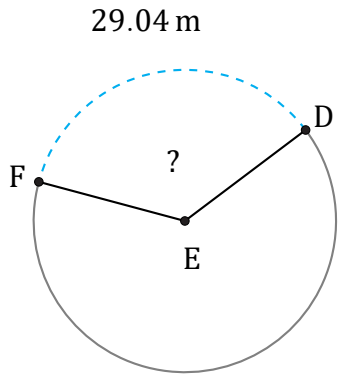

Diameter = 26 m

∠DEF =

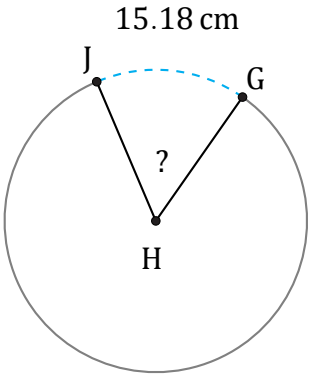

Diameter = 30 cm

∠GHJ =

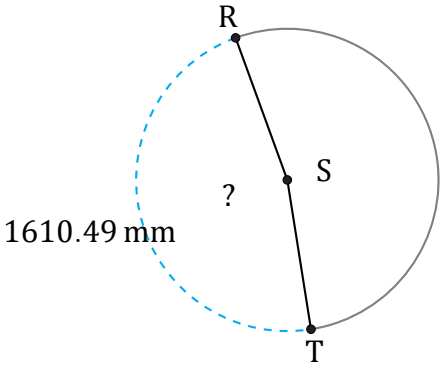

Diameter = 1092 mm

∠RST =