Arc Lengths and Angles (A)

Name: _____ Date: _____

Calculate each arc length or angle measurement.

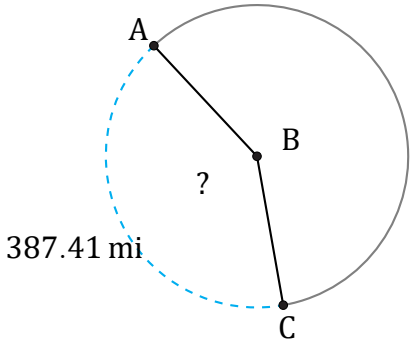

Diameter = 302 mi

$\angle ABC$ =

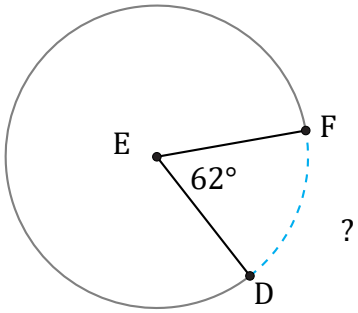

Diameter = 1532 cm

$\overset{\frown}{DF}$ =

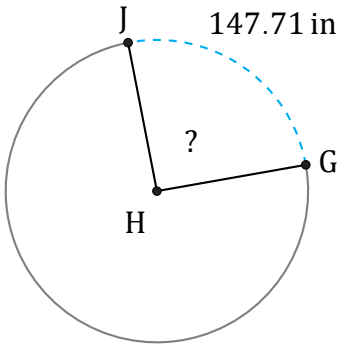

Diameter = 186 in

$\angle GHJ$ =

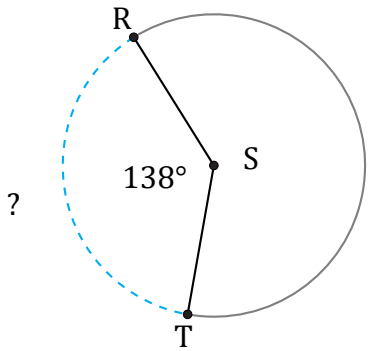

Diameter = 834 km

$\overset{\frown}{RT}$ =