Perimeter and Area of Rectangles (E)

Calculate the perimeter and area for each rectangle.

1.

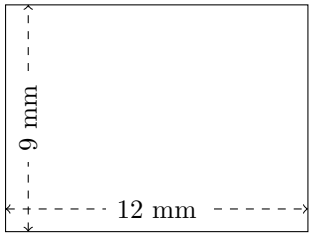

P = ?
A = ?

2.

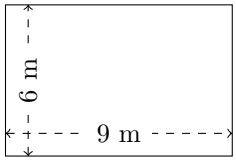

P = ?
A = ?

3.

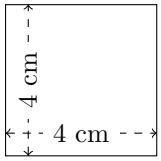

P = ?
A = ?

4.

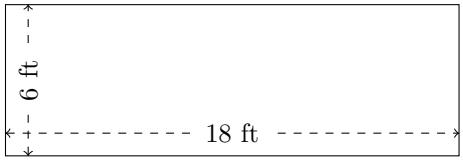

P = ?
A = ?

5.

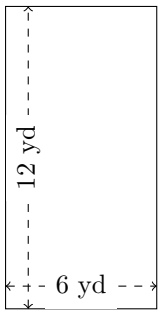

P = ?
A = ?

6.

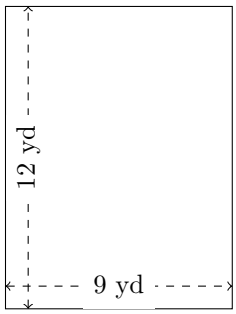

P = ?
A = ?

Perimeter and Area of Rectangles (E) Answers

Calculate the perimeter and area for each rectangle.

1.

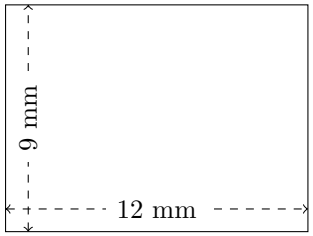

P = 42 mm

A = 108 mm^2

2.

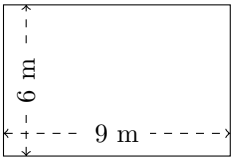

P = 30 m

A = 54 m^2

3.

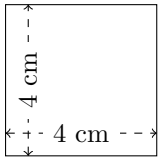

P = 16 cm

A = 16 cm^2

4.

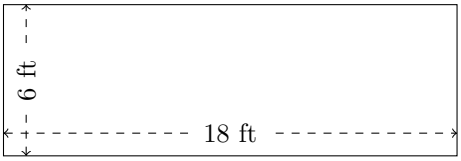

P = 48 ft

A = 108 ft^2

5.

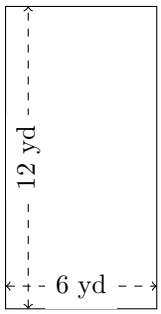

P = 36 yd

A = 72 yd^2

6.

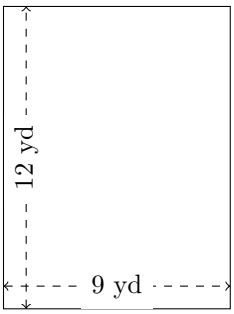

P = 42 yd

A = 108 yd^2