Perimeter and Area of Triangles (J)

Calculate the perimeter and area for each triangle.

1.

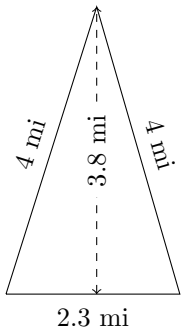

P = ? mi
A = ? mi^2

2.

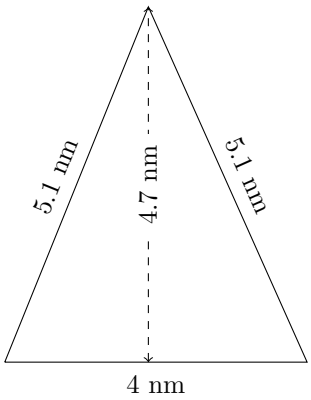

P = ? nm
A = ? nm^2

3.

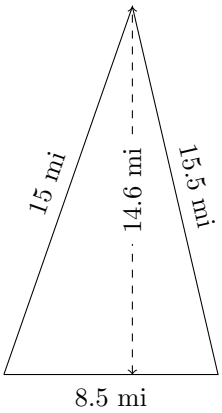

P = ? mi
A = ? mi^2

4.

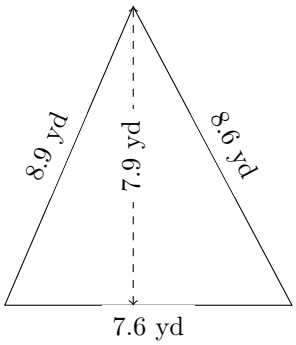

P = ? yd
A = ? yd^2

5.

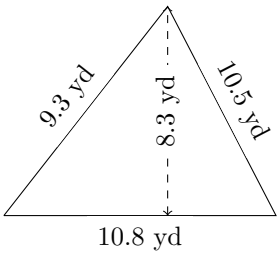

P = ? yd
A = ? yd^2

6.

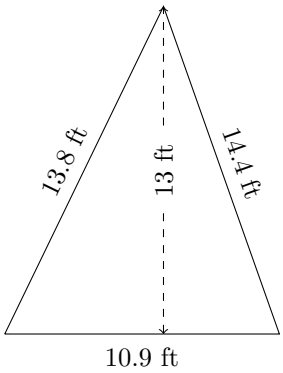

P = ? ft
A = ? ft^2