Perimeter and Area of Triangles (A)

Calculate the perimeter and area for each triangle.

1.

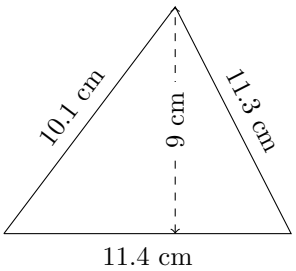

P = ? cm
A = ? cm^2

2.

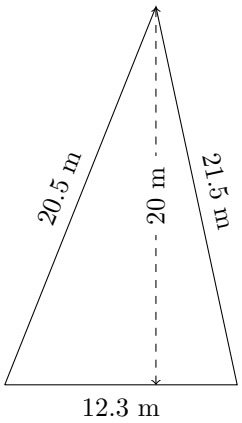

P = ? m
A = ? m^2

3.

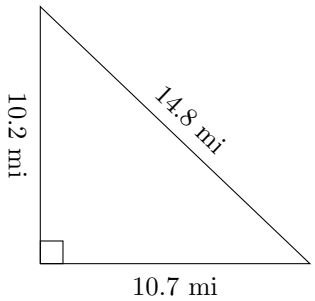

P = ? mi
A = ? mi^2

4.

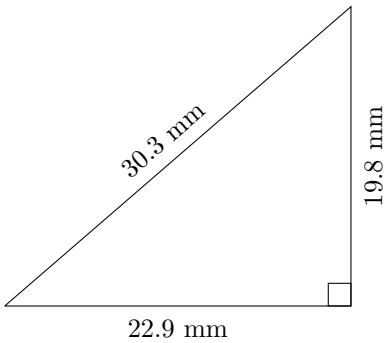

P = ? mm
A = ? mm^2

5.

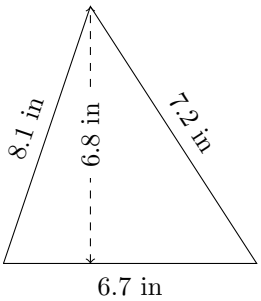

P = ? in
A = ? in^2

6.

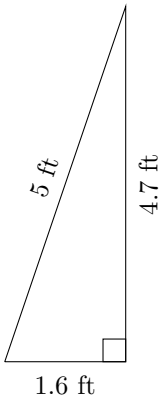

P = ? ft
A = ? ft^2

Perimeter and Area of Triangles (A) Answers

Calculate the perimeter and area for each triangle.

1.

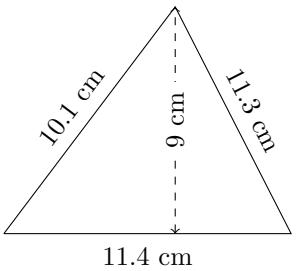

P = 32.8 cm
A = 51.3 cm^2

2.

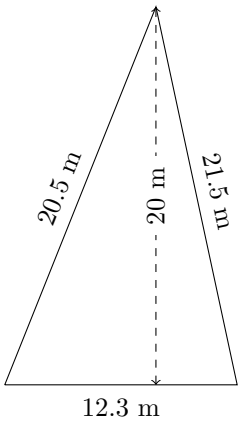

P = 54.3 m
A = 123 m^2

3.

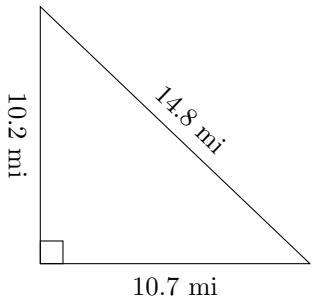

P = 35.7 mi
A = 54.57 mi^2

4.

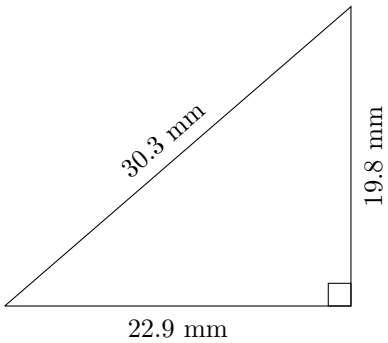

P = 73 mm
A = 226.71 mm^2

5.

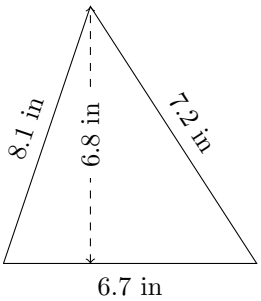

P = 22 in
A = 22.78 in^2

6.

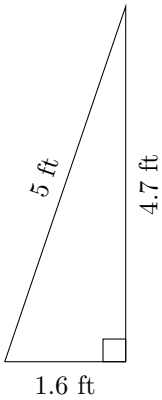

P = 11.3 ft
A = 3.76 ft^2

Perimeter and Area of Triangles (B)

Calculate the perimeter and area for each triangle.

1.

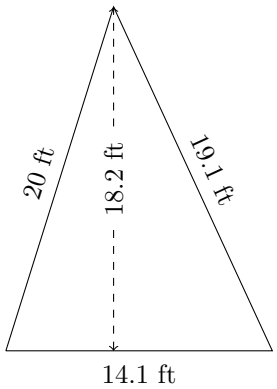

P = ? ft
A = ? ft^2

2.

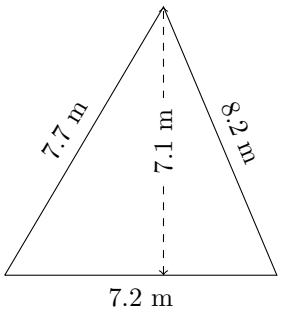

P = ? m
A = ? m^2

3.

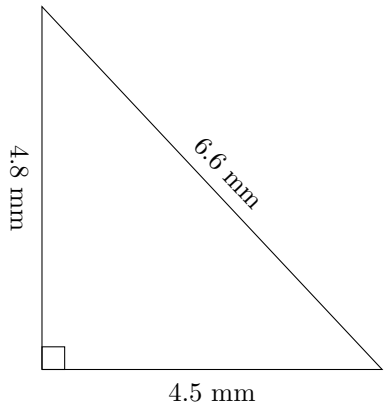

P = ? mm
A = ? mm^2

4.

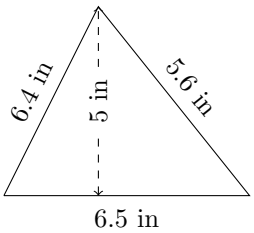

P = ? in
A = ? in^2

5.

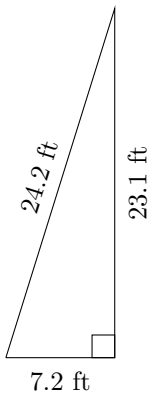

P = ? ft
A = ? ft^2

6.

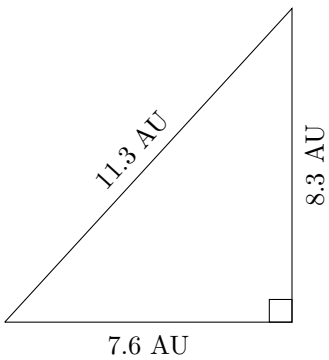

P = ? AU
A = ? AU^2

Perimeter and Area of Triangles (B) Answers

Calculate the perimeter and area for each triangle.

1.

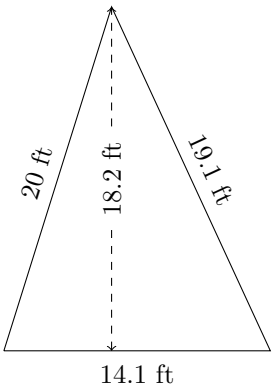

P = 53.2 ft
A = 128.31 ft^2

2.

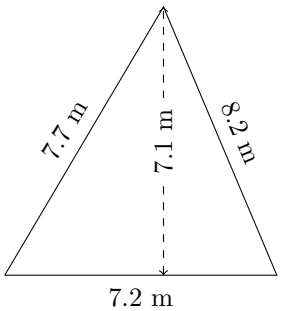

P = 23.1 m
A = 25.56 m^2

3.

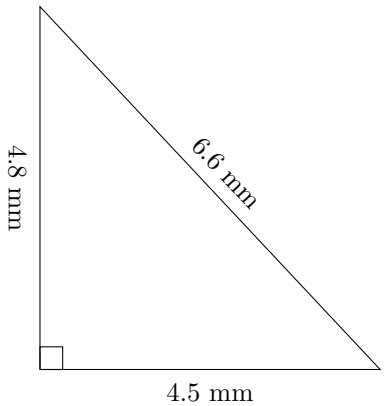

P = 15.9 mm
A = 10.8 mm^2

4.

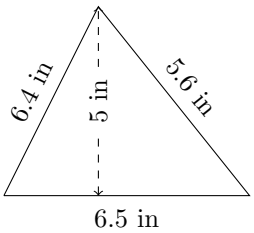

P = 18.5 in
A = 16.25 in^2

5.

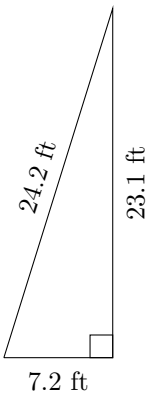

P = 54.5 ft
A = 83.16 ft^2

6.

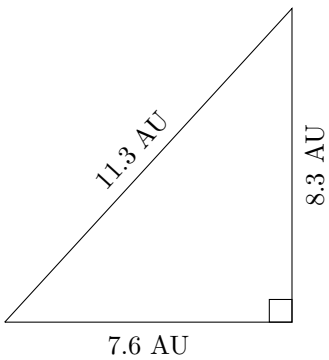

P = 27.2 AU
A = 31.54 AU^2

Perimeter and Area of Triangles (C)

Calculate the perimeter and area for each triangle.

1.

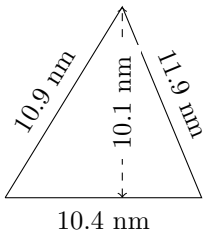

P = ? nm
A = ? nm^2

2.

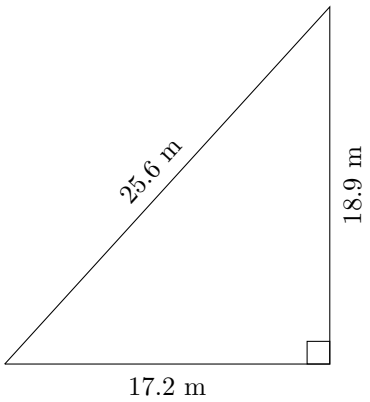

P = ? m
A = ? m^2

3.

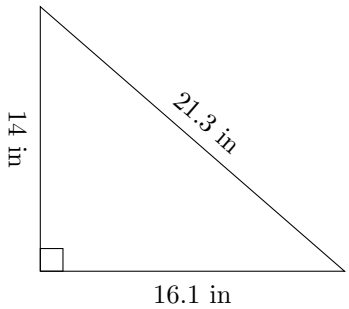

P = ? in
A = ? in^2

4.

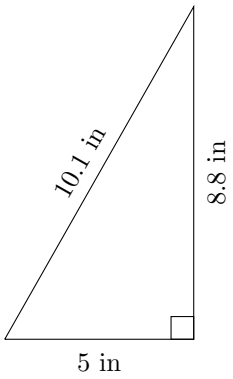

P = ? in
A = ? in^2

5.

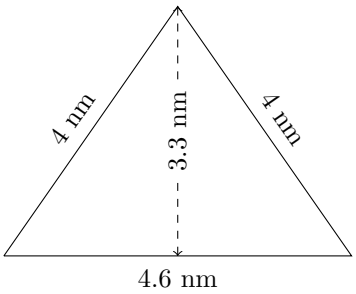

P = ? nm
A = ? nm^2

6.

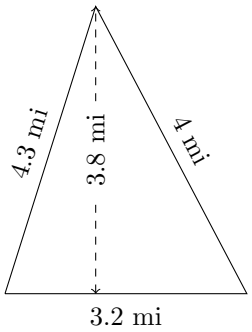

P = ? mi
A = ? mi^2

Perimeter and Area of Triangles (C) Answers

Calculate the perimeter and area for each triangle.

1.

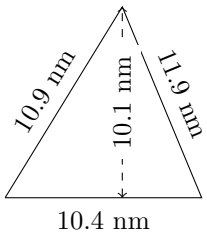

P = 33.2 nm
A = 52.52 nm^2

2.

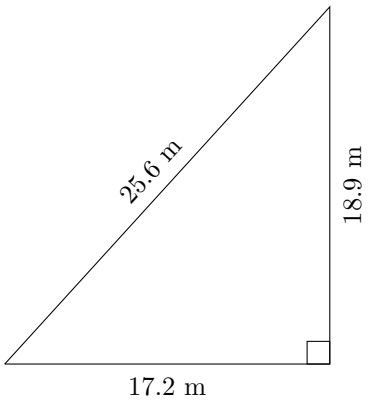

P = 61.7 m
A = 162.54 m^2

3.

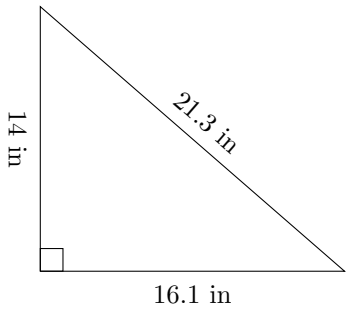

P = 51.4 in
A = 112.7 in^2

4.

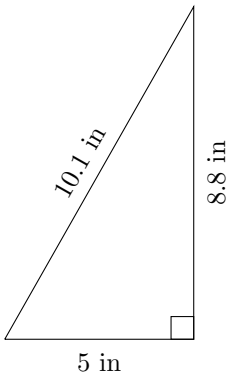

P = 23.9 in
A = 22 in^2

5.

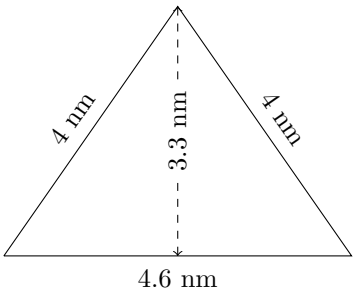

P = 12.6 nm
A = 7.59 nm^2

6.

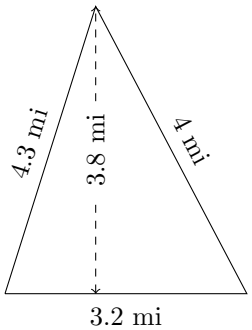

P = 11.5 mi
A = 6.08 mi^2

Perimeter and Area of Triangles (D)

Calculate the perimeter and area for each triangle.

1.

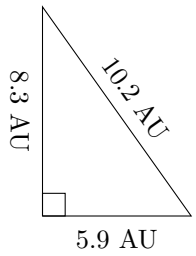

P = ? AU
A = ? AU^2

2.

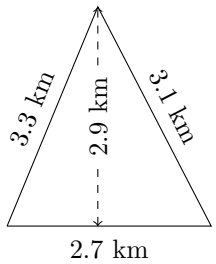

P = ? km
A = ? km^2

3.

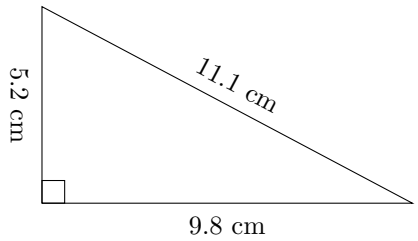

P = ? cm
A = ? cm^2

4.

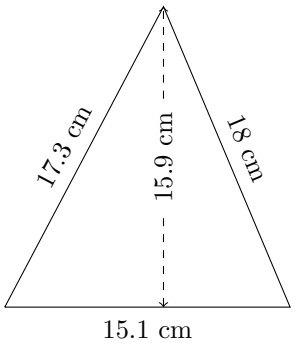

P = ? cm
A = ? cm^2

5.

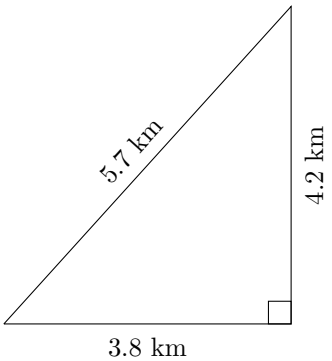

P = ? km
A = ? km^2

6.

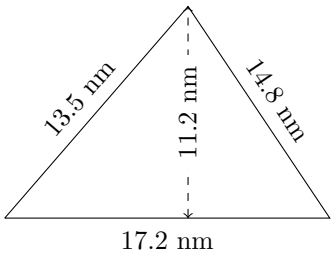

P = ? nm
A = ? nm^2

Perimeter and Area of Triangles (D) Answers

Calculate the perimeter and area for each triangle.

1.

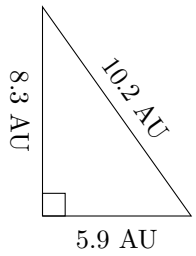

P = 24.4 AU
A = 24.485 AU^2

2.

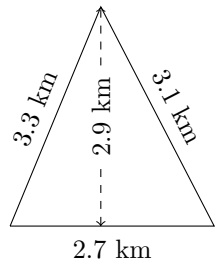

P = 9.1 km
A = 3.915 km^2

3.

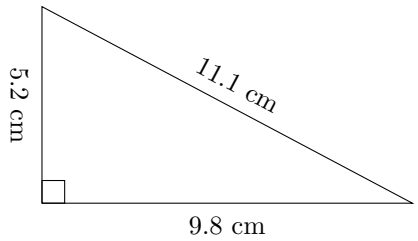

P = 26.1 cm
A = 25.48 cm^2

4.

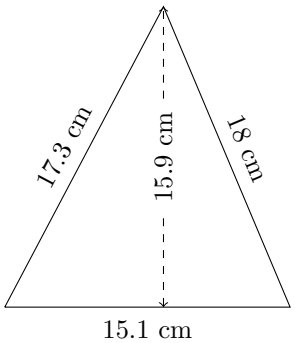

P = 50.4 cm
A = 120.045 cm^2

5.

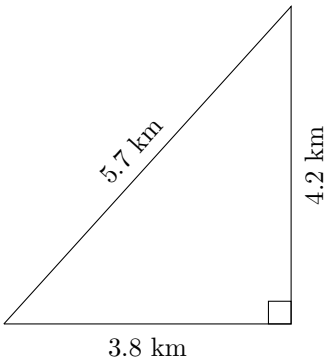

P = 13.7 km
A = 7.98 km^2

6.

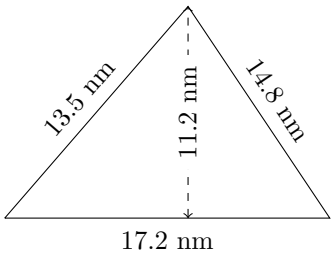

P = 45.5 nm
A = 96.32 nm^2

Perimeter and Area of Triangles (E)

Calculate the perimeter and area for each triangle.

1.

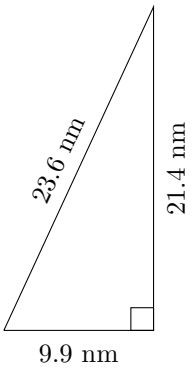

P = ? nm
A = ? nm^2

2.

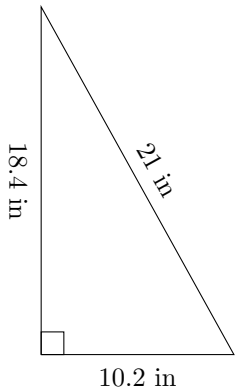

P = ? in
A = ? in^2

3.

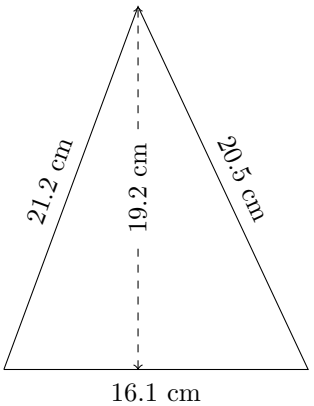

P = ? cm
A = ? cm^2

4.

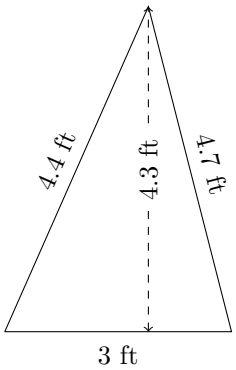

P = ? ft
A = ? ft^2

5.

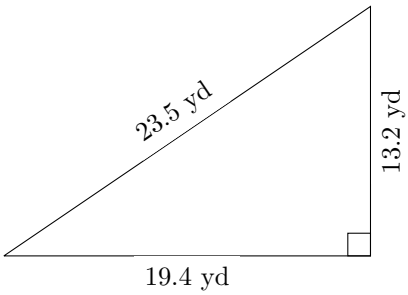

P = ? yd
A = ? yd^2

6.

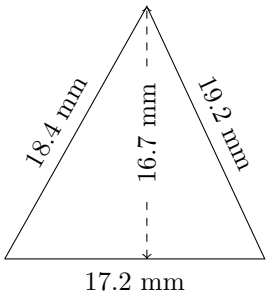

P = ? mm
A = ? mm^2

Perimeter and Area of Triangles (E) Answers

Calculate the perimeter and area for each triangle.

1.

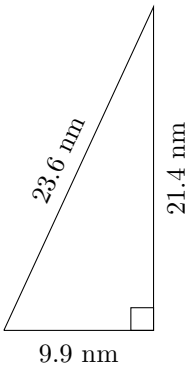

P = 54.9 nm
A = 105.93 nm^2

2.

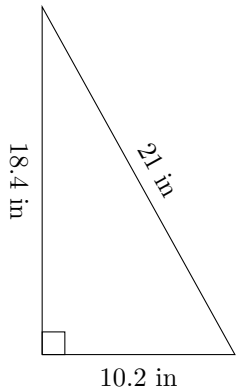

P = 49.6 in
A = 93.84 in^2

3.

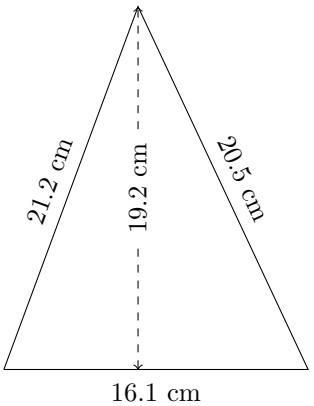

P = 57.8 cm
A = 154.56 cm^2

4.

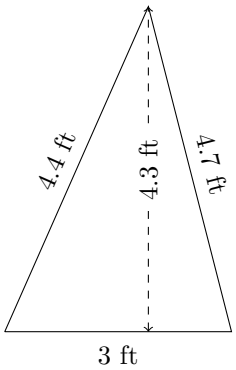

P = 12.1 ft
A = 6.45 ft^2

5.

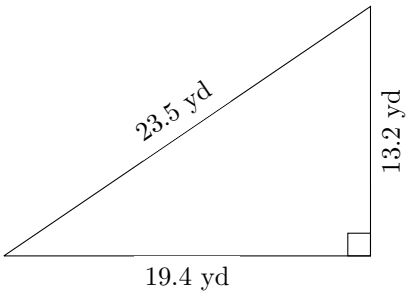

P = 56.1 yd
A = 128.04 yd^2

6.

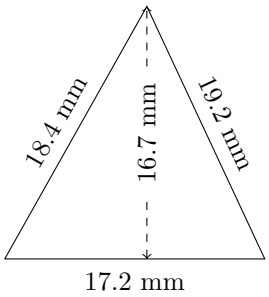

P = 54.8 mm
A = 143.62 mm^2

Perimeter and Area of Triangles (F)

Calculate the perimeter and area for each triangle.

1.

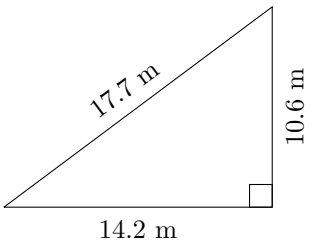

P = ? m
A = ? m^2

2.

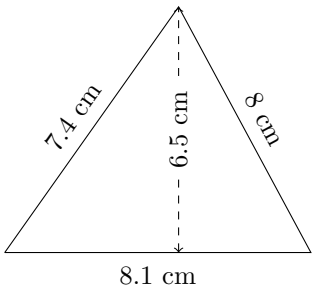

P = ? cm
A = ? cm^2

3.

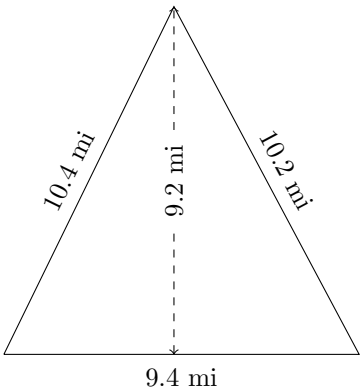

P = ? mi
A = ? mi^2

4.

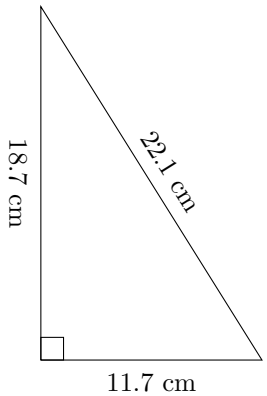

P = ? cm
A = ? cm^2

5.

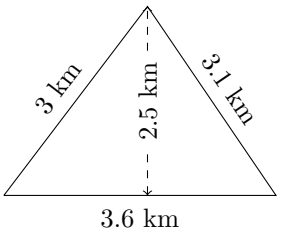

P = ? km
A = ? km^2

6.

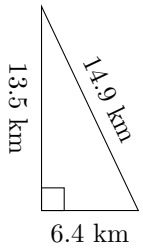

P = ? km
A = ? km^2

Perimeter and Area of Triangles (F) Answers

Calculate the perimeter and area for each triangle.

1.

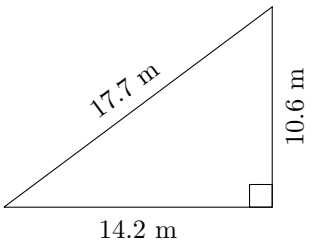

P = 42.5 m
A = 75.26 m^2

2.

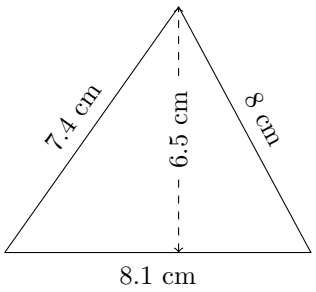

P = 23.5 cm
A = 26.325 cm^2

3.

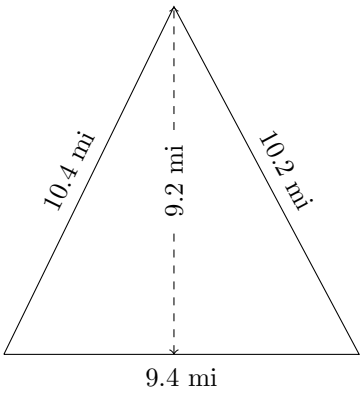

P = 30 mi
A = 43.24 mi^2

4.

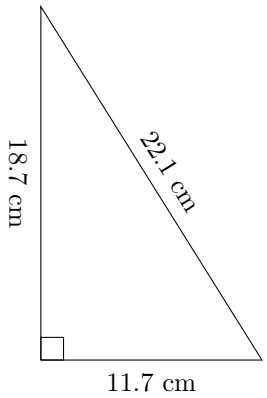

P = 52.5 cm
A = 109.395 cm^2

5.

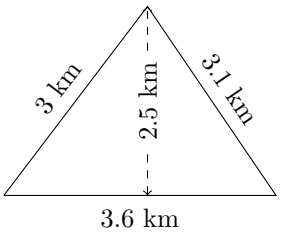

P = 9.7 km
A = 4.5 km^2

6.

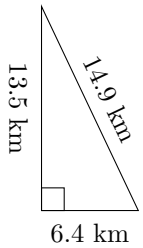

P = 34.8 km
A = 43.2 km^2

Perimeter and Area of Triangles (G)

Calculate the perimeter and area for each triangle.

1.

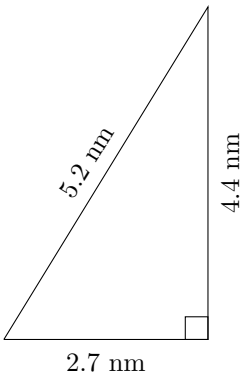

P = ? nm
A = ? nm^2

2.

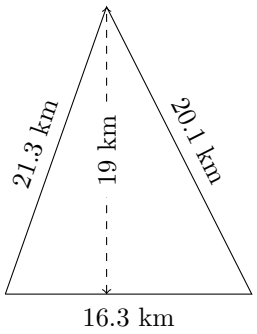

P = ? km
A = ? km^2

3.

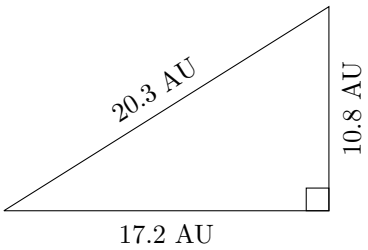

P = ? AU
A = ? AU^2

4.

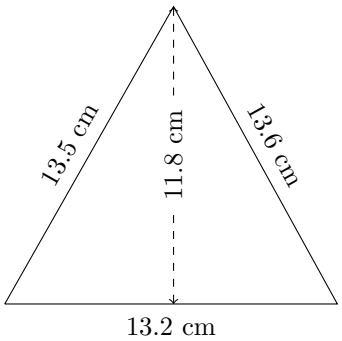

P = ? cm
A = ? cm^2

5.

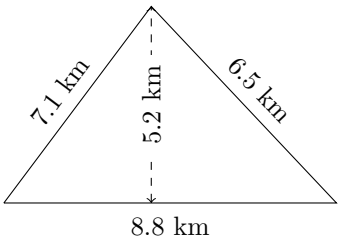

P = ? km
A = ? km^2

6.

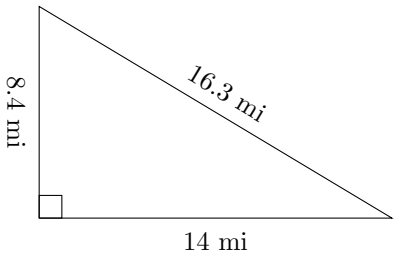

P = ? mi
A = ? mi^2

Perimeter and Area of Triangles (G) Answers

Calculate the perimeter and area for each triangle.

1.

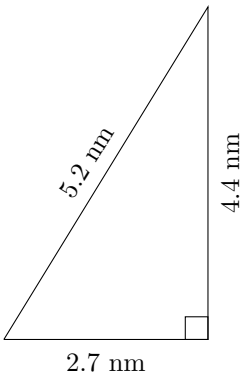

P = 12.3 nm
A = 5.94 nm^2

2.

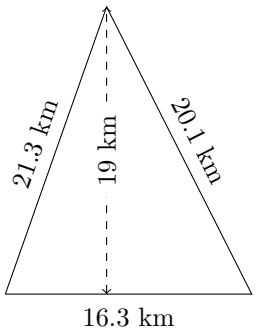

P = 57.7 km
A = 154.85 km^2

3.

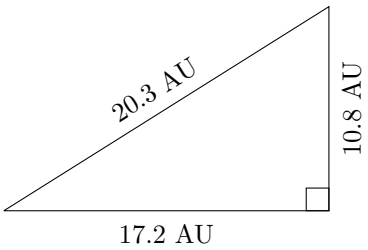

P = 48.3 AU
A = 92.88 AU^2

4.

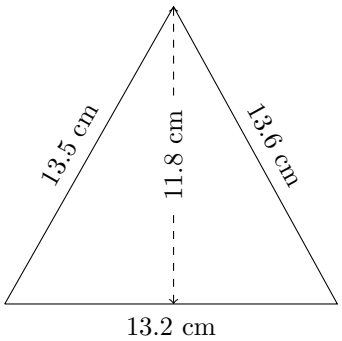

P = 40.3 cm
A = 77.88 cm^2

5.

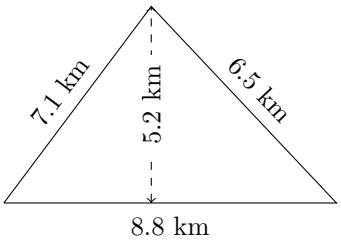

P = 22.4 km
A = 22.88 km^2

6.

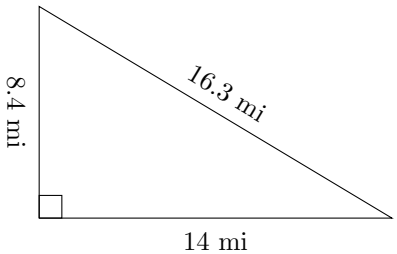

P = 38.7 mi
A = 58.8 mi^2

Perimeter and Area of Triangles (H)

Calculate the perimeter and area for each triangle.

1.

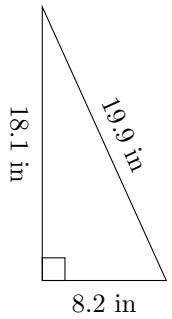

P = ? in
A = ? in^2

2.

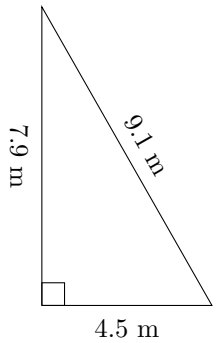

P = ? m
A = ? m^2

3.

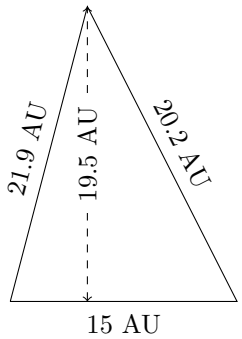

P = ? AU
A = ? AU^2

4.

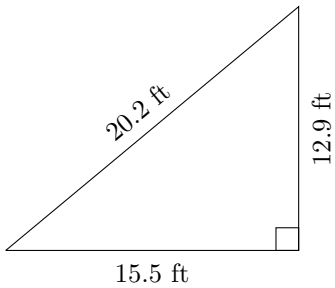

P = ? ft
A = ? ft^2

5.

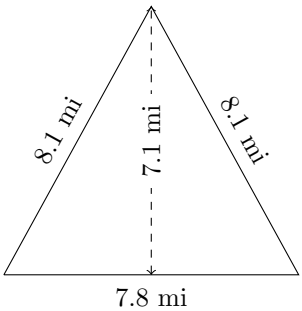

P = ? mi
A = ? mi^2

6.

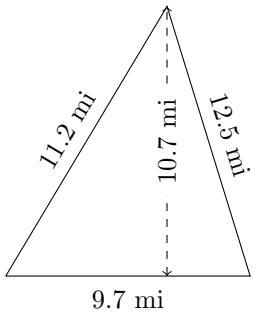

P = ? mi
A = ? mi^2

Perimeter and Area of Triangles (H) Answers

Calculate the perimeter and area for each triangle.

1.

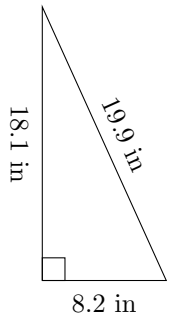

P = 46.2 in
A = 74.21 in^2

2.

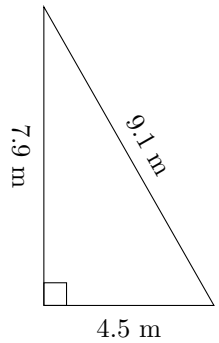

P = 21.5 m
A = 17.775 m^2

3.

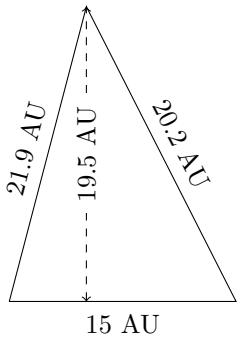

P = 57.1 AU
A = 146.25 AU^2

4.

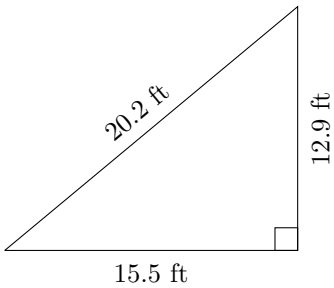

P = 48.6 ft
A = 99.975 ft^2

5.

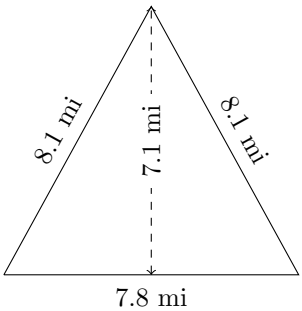

P = 24 mi
A = 27.69 mi^2

6.

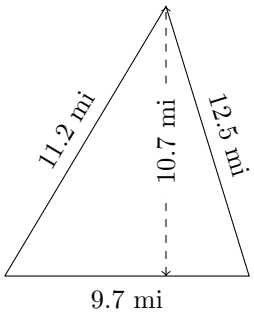

P = 33.4 mi
A = 51.895 mi^2

Perimeter and Area of Triangles (I)

Calculate the perimeter and area for each triangle.

1.

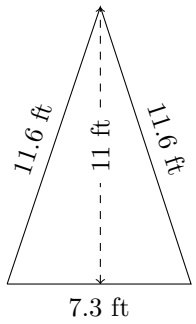

P = ? ft
A = ? ft^2

2.

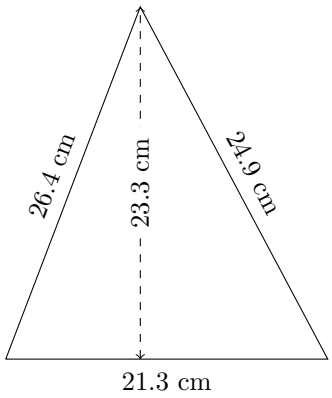

P = ? cm
A = ? cm^2

3.

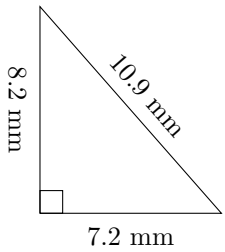

P = ? mm
A = ? mm^2

4.

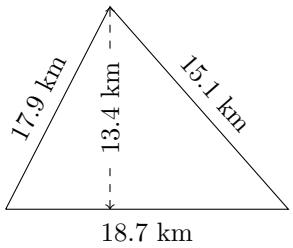

P = ? km
A = ? km^2

5.

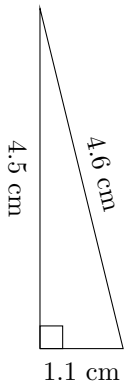

P = ? cm
A = ? cm^2

6.

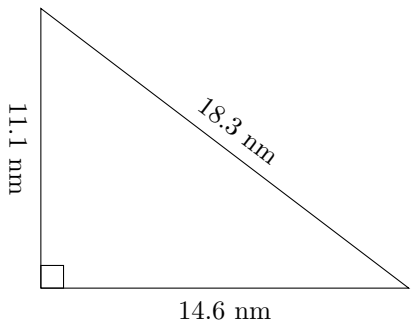

P = ? nm
A = ? nm^2

Perimeter and Area of Triangles (I) Answers

Calculate the perimeter and area for each triangle.

1.

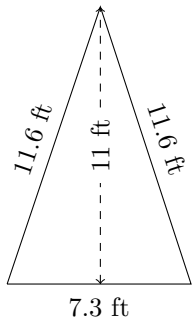

P = 30.5 ft
A = 40.15 ft^2

2.

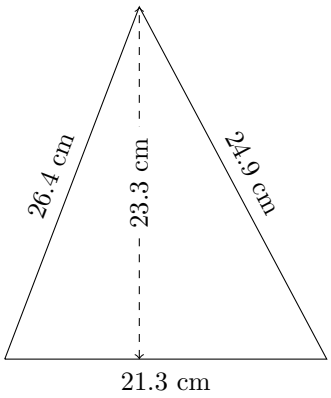

P = 72.6 cm
A = 248.145 cm^2

3.

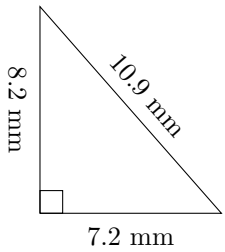

P = 26.3 mm
A = 29.52 mm^2

4.

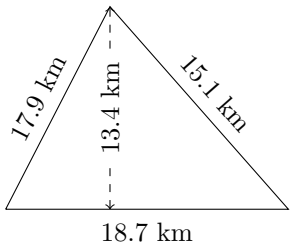

P = 51.7 km
A = 125.29 km^2

5.

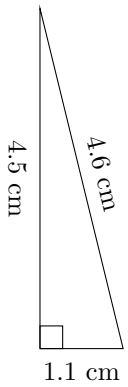

P = 10.2 cm
A = 2.475 cm^2

6.

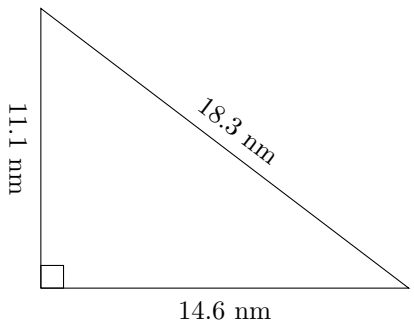

P = 44 nm
A = 81.03 nm^2

Perimeter and Area of Triangles (J)

Calculate the perimeter and area for each triangle.

1.

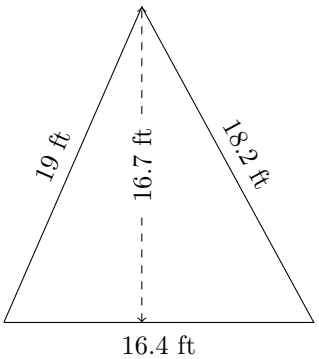

P = ? ft
A = ? ft^2

2.

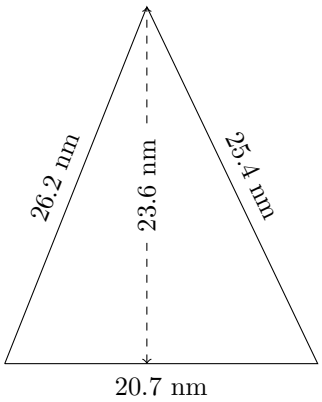

P = ? nm
A = ? nm^2

3.

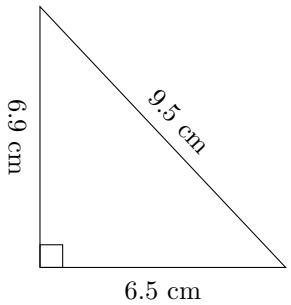

P = ? cm
A = ? cm^2

4.

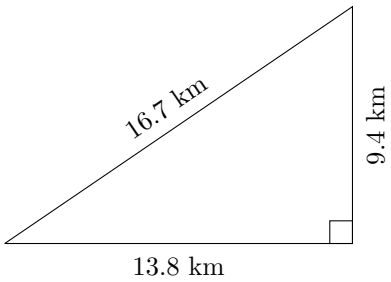

P = ? km
A = ? km^2

5.

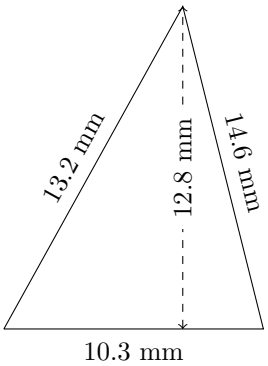

P = ? mm
A = ? mm^2

6.

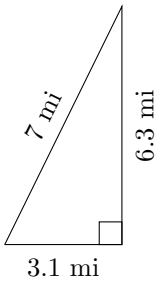

P = ? mi
A = ? mi^2

Perimeter and Area of Triangles (J) Answers

Calculate the perimeter and area for each triangle.

1.

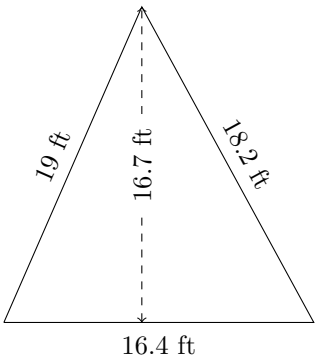

P = 53.6 ft
A = 136.94 ft^2

2.

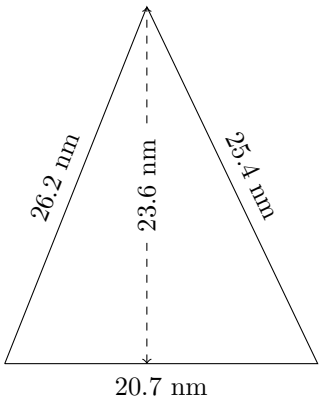

P = 72.3 nm
A = 244.26 nm^2

3.

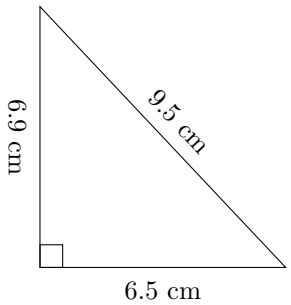

P = 22.9 cm
A = 22.425 cm^2

4.

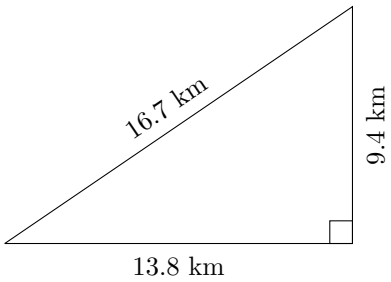

P = 39.9 km
A = 64.86 km^2

5.

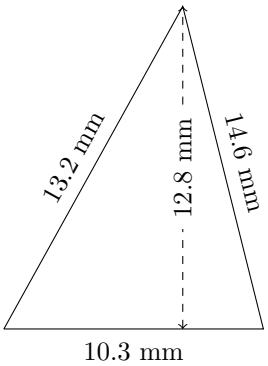

P = 38.1 mm
A = 65.92 mm^2

6.

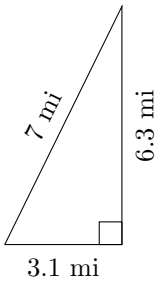

P = 16.4 mi
A = 9.765 mi^2