Triangles Measurements (J)

Calculate the missing measurements for each triangle.

1.

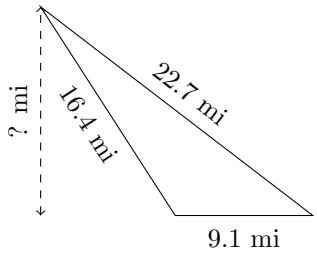

P = ? mi
A = 62.79 mi^2

2.

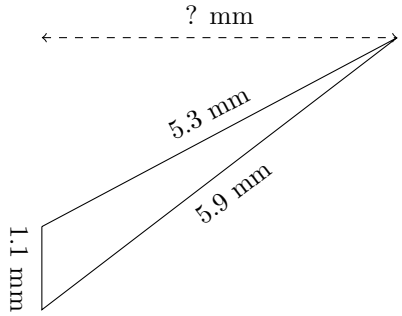

P = ? mm
A = 2.585 mm^2

3.

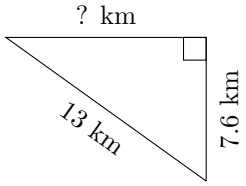

P = ? km
A = 40.28 km^2

4.

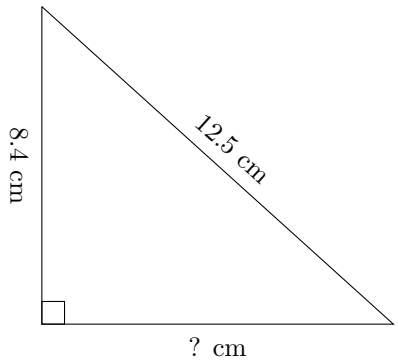

P = ? cm
A = 39.06 cm^2

5.

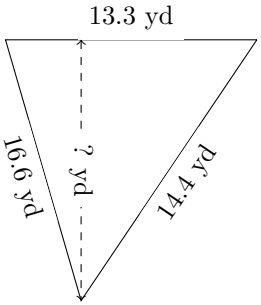

P = ? yd
A = 91.77 yd^2

6.

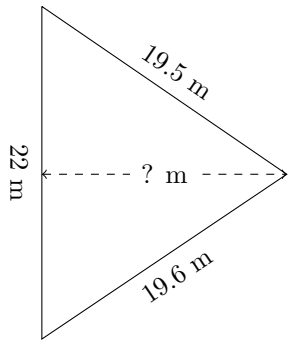

P = ? m
A = 178.2 m^2