Triangles Measurements (B)

Calculate the area of each triangle using Heron's formula.

1.

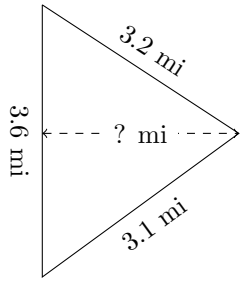

P = ? mi
A = ? mi^2

2.

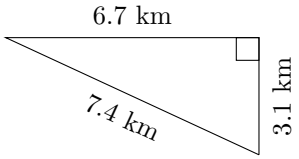

P = ? km
A = ? km^2

3.

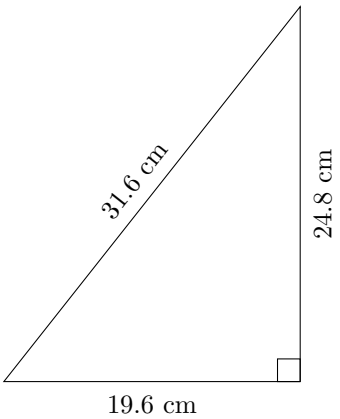

P = ? cm
A = ? cm^2

4.

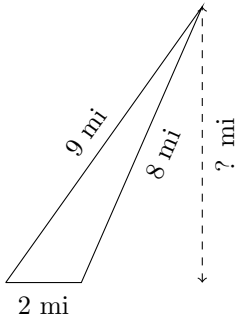

P = ? mi
A = ? mi^2

5.

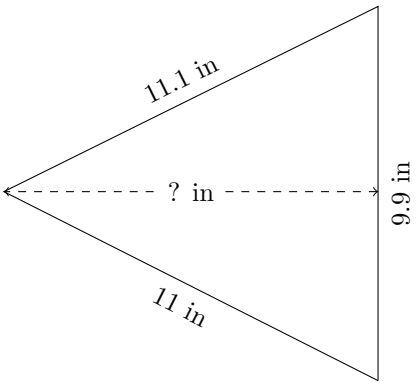

P = ? in
A = ? in^2

6.

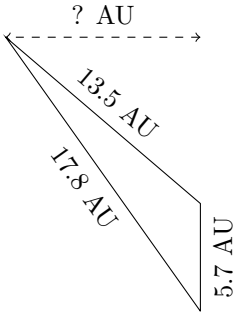

P = ? AU
A = ? AU^2

Triangles Measurements (B) Answers

Calculate the area of each triangle using Heron's formula.

1.

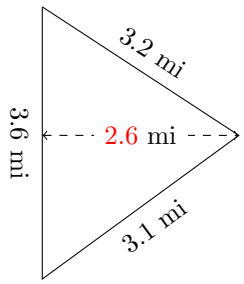

P = 9.9 mi
A = 4.651 mi^2

2.

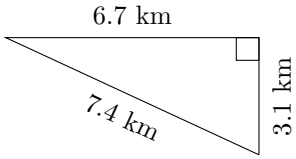

P = 17.2 km
A = 10.385 km^2

3.

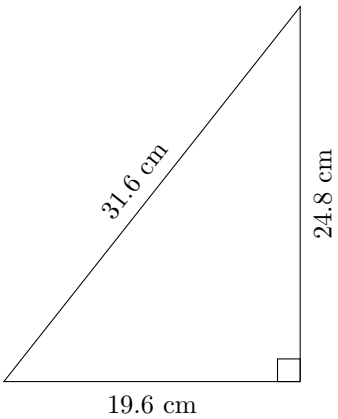

P = 76 cm
A = 243.04 cm^2

4.

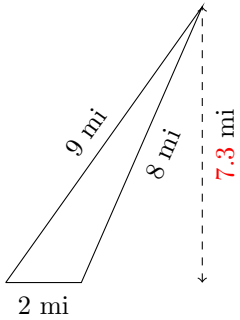

P = 19 mi
A = 7.31 mi^2

5.

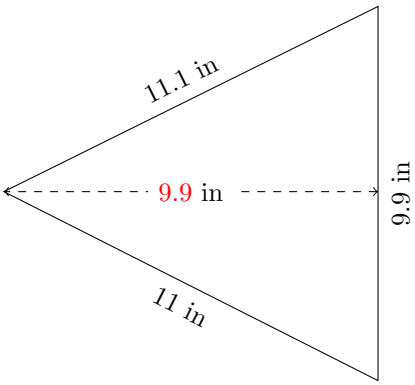

P = 32 in
A = 48.9 in^2

6.

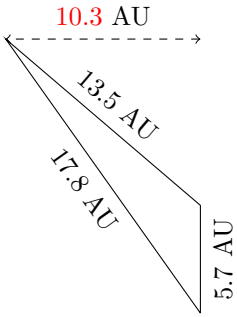

P = 37 AU
A = 28.789 AU^2