Counting U.S. Coins (I)

What is the value of each set of coins?

1.



_____

2.




_____

3.

_____

United States coin images from the United States Mint.

Counting U.S. Coins (I) Answers

What is the value of each set of coins?

1.

$5.37

2.



$5.35

3.

$4.24

United States coin images from the United States Mint.