Adding on Number Lines (D)

Use the number lines to calculate each sum.

1. $15 + 5 =$ ____

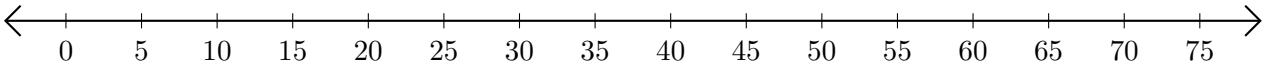

2. $20 + 40 =$ ____

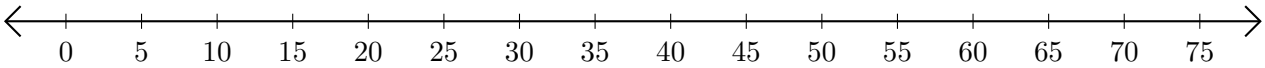

3. $25 + 25 =$ ____

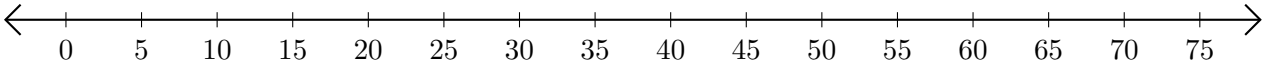

4. $35 + 5 =$ ____

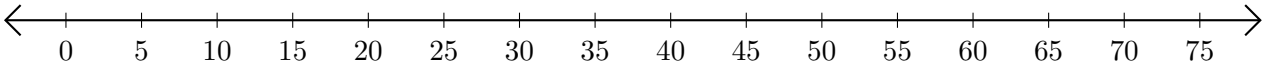
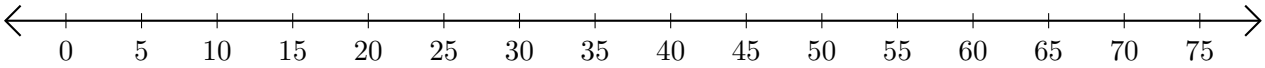
5. $30 + 25 =$ ____