Adding on Number Lines (J)

Use the number lines to calculate each sum.

1. $45 + 30 =$ ____

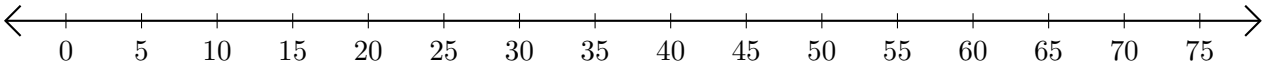

2. $65 + 10 =$ ____

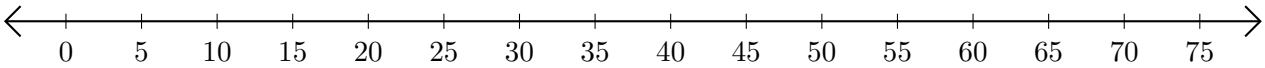

3. $15 + 40 =$ ____

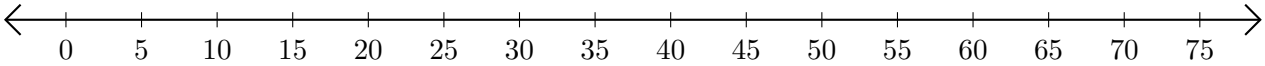

4. $5 + 50 =$ ____

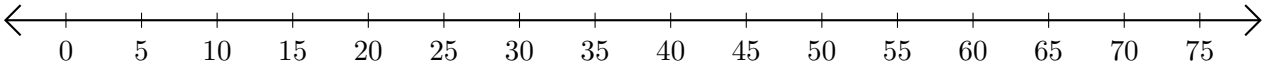
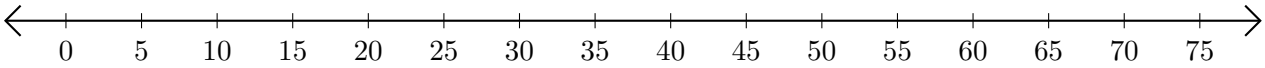
5. $70 + 5 =$ ____