Adding and Subtracting on Number Lines (H)

Use the number lines to calculate each sum or difference.

1. $24 + 6 =$ ____

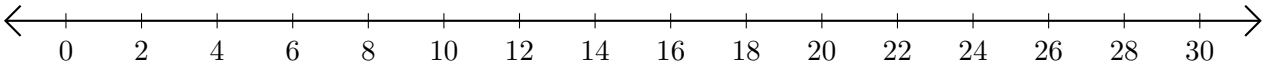

2. $24 - 16 =$ ___

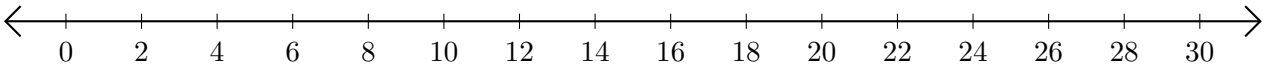

3. $8 + 12 =$ ____

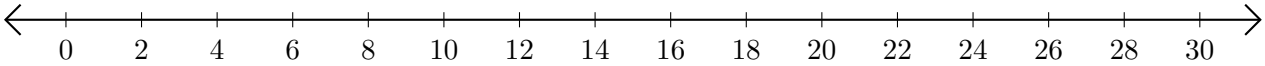

4. $24 - 14 =$ ____

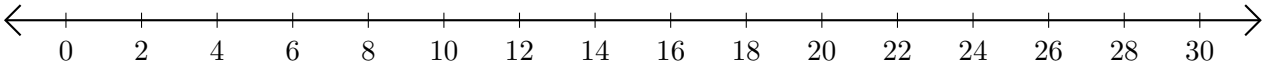

5. $24 - 22 =$ ___

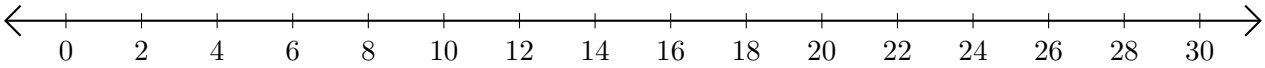

Adding and Subtracting on Number Lines (H) Answers

Use the number lines to calculate each sum or difference.

1. $24 + 6 =$ 30

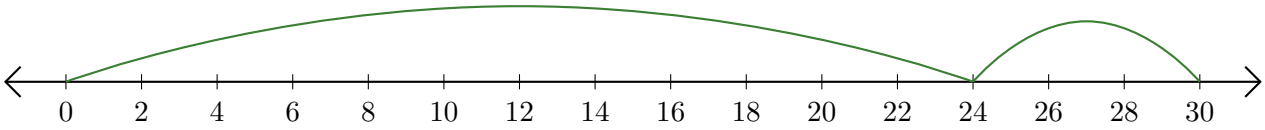

2. $24 - 16 =$ 8

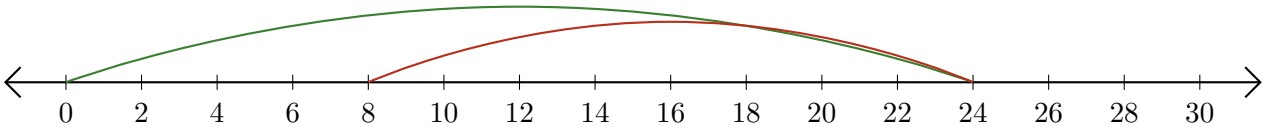

3. $8 + 12 =$ 20

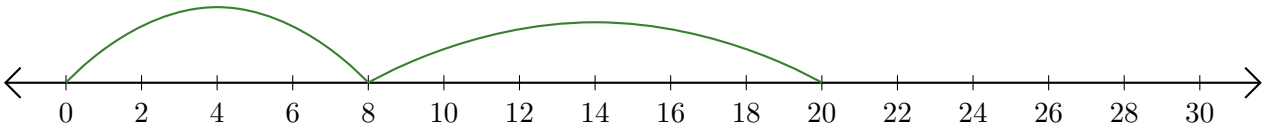

4. $24 - 14 =$ 10

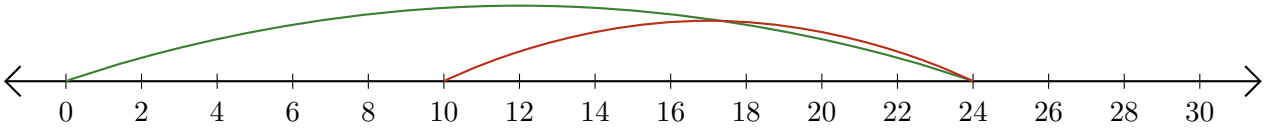
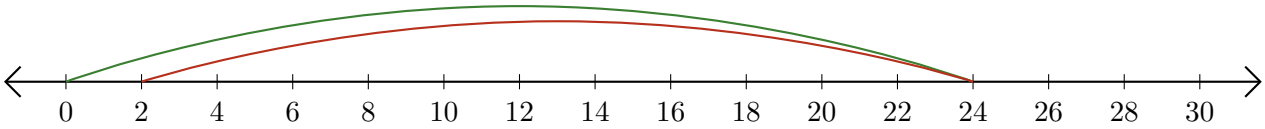
5. $24 - 22 =$ 2