Subtracting on Number Lines (J)

Use the number lines to calculate each difference.

1. $120 - 110 =$ ____

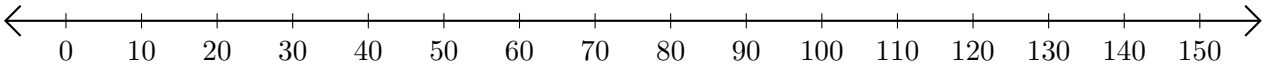

2. $150 - 60 =$ ____

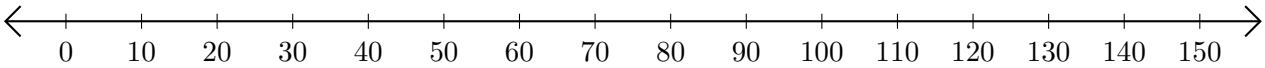

3. $90 - 70 =$ ____

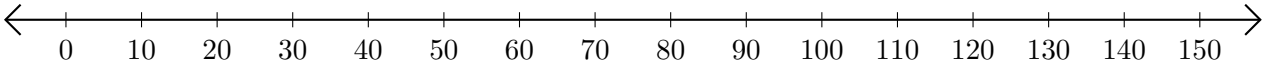

4. $130 - 10 =$ _____

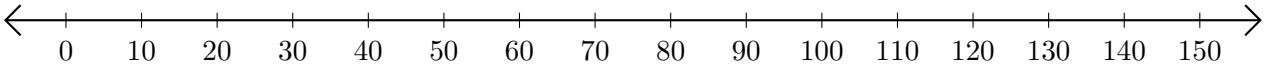
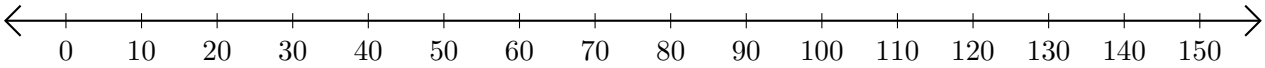
5. $150 - 90 =$ ____