Placing Numbers on Number Lines (F)

Name: _____ Date: _____ Score: _____

Draw a star at the place on the number line where you would find each number.

0



8000



7000



2000

6000



5000



9000



10,000



4000

3000