Placing Numbers on Number Lines (A)

Name: _____ Date: _____ Score: _____

Draw a star at the place on the number line where you would find each number.

879

409

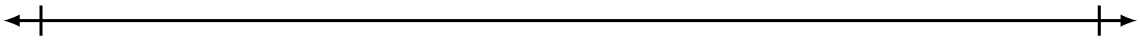

379

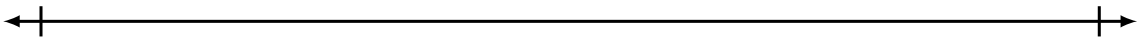

89



783



155



677

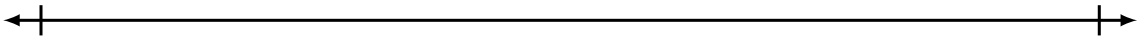

245



534



929