Counting Animals (I)

Count the number of animals in each group.

____



____

____

____



Counting Animals (I) Answers

Count the number of animals in each group.

10



5

7

8