Prime Factors (G)

Use a tree diagram to find the prime factors of each number.

122

28

75

57

28

123

94

104

88

Prime Factors (G) Answers

Use a tree diagram to find the prime factors of each number.

122

$122 = 2 \times 61$

28

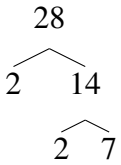

$28 = 2^2 \times 7$

75

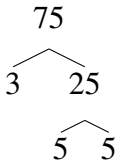

$75 = 3 \times 5^2$

57

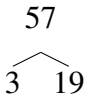

$57 = 3 \times 19$

28

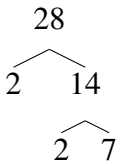

$28 = 2^2 \times 7$

123

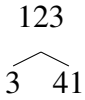

$123 = 3 \times 41$

94

$94 = 2 \times 47$

104

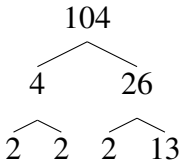

$104 = 2^3 \times 13$

88

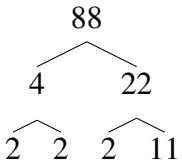

$88 = 2^3 \times 11$