Reading Time on Analog Clocks (I)

Name: _____ Date: _____

Read each time and write it in the space under the clock.

1. 

_____

2. 

_____

3. 

_____

4.

_____

5. 

_____

6. 

_____

7. 

_____

8.

_____

9. 

_____

10.

_____

11.

_____

12. 

_____