Reading Time on Analog Clocks (D)

Name: _____ Date: _____

Read each time and write it in the space under the clock.

1.



_____

2.



_____

3.



_____

4.

_____

Reading Time on Analog Clocks (D) Answers

Name: _____ Date: _____

Read each time and write it in the space under the clock.

1.

04:55:32

2.



06:41:52

3.

16:49:18

4.

23:57:24