Reading Time on Analog Clocks (C)

Name: _____ Date: _____

Read each time and write it in the space under the clock.

1.


_____

2.

_____

3.


_____

4.

_____

5.


_____

6.


_____

7.


_____

8.


_____

9.


_____

10.

_____

11.

_____

12.


_____