Sketching Time on Analog Clocks (C)

Name: _____ Date: _____

Sketch each time on the clock face above it.

1.



02:23

2.



20:47

3.



06:56

4.



16:44