Sketching Time on Analog Clocks (D)

Name: _____ Date: _____

Sketch each time on the clock face above it.

1.



23:20

2.



13:02

3.



02:36

4.



07:53