Sketching Time on Analog Clocks (B)

Name: _____ Date: _____

Sketch each time on the clock face above it.

1. 

12:00

2. 

08:30

3. 

17:15

4. 

01:30

5.

04:30

6. 

03:00

7. 

06:00

8. 

10:45

9. 

19:45

10. 

14:15

11. 

20:15

12. 

23:45