Sketching Time on Analog Clocks (H)

Name: _____ Date: _____

Sketch each time on the clock face above it.

1.



19:00

2.



11:00

3.



15:00

4.



04:00