Sketching Time on Analog Clocks (H)

Name: _____ Date: _____

Sketch each time on the clock face above it.

1. 

02:47:23

2. 

01:25:54

3. 

19:11:56

4.

23:08:34

5. 

21:43:32

6. 

11:58:59

7.

16:09:36

8. 

08:47:50

9. 

14:11:15

10. 

12:37:33

11. 

04:48:12

12. 

07:12:25