Sketching Time on Analog Clocks (C)

Name: _____ Date: _____

Sketch each time on the clock face above it.

1. 

11:36:00

2. 

16:23:30

3. 

01:13:30

4. 

21:44:30

5. 

18:59:45

6. 

13:41:45

7. 

15:50:15

8. 

05:30:15

9. 

22:20:00

10. 

03:40:45

11. 

09:32:15

12. 

07:38:00