Sketching Time on Analog Clocks (E)

Name: _____ Date: _____

Sketch each time on the clock face above it.

1. 

15:05:15

2. 

07:50:15

3. 

23:28:45

4. 

17:36:00

5. 

01:25:30

6. 

18:32:00

7. 

05:58:30

8. 

02:08:45

9. 

13:55:00

10. 

20:34:45

11. 

10:15:15

12. 

09:54:30