Sketching Time on Analog Clocks (E)

Name: _____ Date: _____

Sketch each time on the clock face above it.

1. 

2:00 AM

2. 

4:00 PM

3. 

4:00 AM

4. 

11:00 AM

5. 

6:00 AM

6.

3:00 PM

7. 

11:00 PM

8. 

8:00 AM

9. 

1:00 AM

10. 

1:00 PM

11.

7:00 PM

12.

8:00 PM

Sketching Time on Analog Clocks (E) Answers

Name: _____ Date: _____

Sketch each time on the clock face above it.

1. 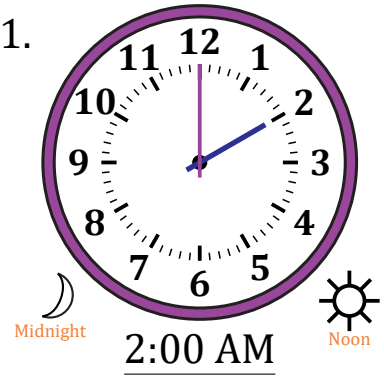

2:00 AM

2. 

4:00 PM

3. 

4:00 AM

4. 

11:00 AM

5. 

6:00 AM

6.

3:00 PM

7. 

11:00 PM

8.

8:00 AM

9. 

1:00 AM

10. 

1:00 PM

11.

7:00 PM

12.

8:00 PM