Sketching Time on Analog Clocks (A)

Name: _____ Date: _____

Sketch each time on the clock face above it.

1.

10:39:15 PM

2. 

1:04:20 PM

3. 

10:19:10 AM

4. 

2:50:50 AM

5. 

5:22:30 AM

6. 

6:36:55 PM

7. 

12:36:35 AM

8. 

8:32:45 PM

9. 

9:40:25 AM

10. 

7:26:40 AM

11.

3:33:00 PM

12.

4:07:05 PM

Sketching Time on Analog Clocks (A) Answers

Name: _____ Date: _____

Sketch each time on the clock face above it.

1.

10:39:15 PM

2. 

1:04:20 PM

3. 

10:19:10 AM

4.

2:50:50 AM

5. 

5:22:30 AM

6.

6:36:55 PM

7. 

12:36:35 AM

8.

8:32:45 PM

9. 

9:40:25 AM

10. 

7:26:40 AM

11.

3:33:00 PM

12.

4:07:05 PM